4/30 30%

General Psychology Pre-Test
Spring 2020

1. Cheryl wants to find out if stretching before exercise *causes* people to have less injury during exercise. The best way to answer this question would be to use _____.
   a. a survey
   b. naturalistic observation
   c. an experiment
   d. a correlational procedure

2. Brenda sees clients who are having mental or emotional problems. She has a MD degree, and usually prescribes medication for her clients. Brenda is a _____
   a. psychiatrist
   b. psychologist
   c. psychoanalyst
   d. psychotherapist

3. Studies on similarity and attraction have found that _____.
   a. The more similar two people are, the more relationship satisfaction they report
   b. Similarity appears to be unrelated to attraction
   c. Opposites attract
   d. The more similar two people are, the weaker the attraction, because of boredom

4. The most important situational variable in helping behavior is the …..
   a. weather
   b. time of day
   c. amount of people present
   d. ambiguity of the situation

5. Material is *best* transferred from short-term memory to long-term memory through _____.
   a. deep processing
   b. maintenance rehearsal
   c. chunking
   d. shallow processing

6. Without rehearsal short term memory will last *up to* _____seconds.
   a. 9
   b. 30
   c. 45
   d. 60

14. According to recent research, unmarried adults who live together in a sexual relationship who go on to get married are less likely to get divorced than those who don't live together before marriage.
    a. True
    b. False

15. Freud believed that personality is not formed before the age of 12.
    a. True
    b. False

16. Diane is attracted to her boss, but is embarrassed about feeling this way. She tells her friends that her boss is making advances towards her. Diane is exhibiting a defense mechanism known as _____
    a. regression
    b. projection
    c. displacement
    d. reaction formation

17. Which of the following personality descriptions is associated with the personality trait referred to as conscientiousness?
    a. A quiet, shy, reclusive person
    b. A person who exercises leadership
    c. A good natured and cooperative person
    d. A person who is dependable and responsible

18. Depression is _____ as common in women than in men.
    a. one-third to one-half
    b. just
    c. twice
    d. four to five times

19. Schizophrenia is a(n) _____ disorder.
    a. anxiety
    b. dissociative
    c. personality
    d. psychotic

20. When one derives sexual gratification by watching others in a state of undress or having sexual relations, they would be diagnosed with
    a. exhibitionistic disorder
    b. frotteuristic disorder
    c. sexual sadism disorder
    d. voyeuristic disorder

University of Arkansas Rich Mountain/Mena High School
SPC 203
Oral Communications
Spring 2020

Instructor: Teresa Torix
B.B.A., Business Administration/Accounting, University of Central Arkansas, Conway, Arkansas, 1995
M.B.A., University of Central Arkansas, Conway, Arkansas, 1998
M.A.T., University of Arkansas, Monticello, Monticello, Arkansas, 2014
Class Location/Time: Mena High School – 9:48 – 10:38
Office Hours: Monday – Friday 2:28 – 3:18
Telephone: (479) 394-1144
E-mail: teresa.torix@menaschools.org OR ttorix@uarichmountain.edu

Prerequisite
ACT score of 19 on Reading OR ACCUPLACER passing score

Required Material

1. Textbook: *The Challenge of Effective Speaking,* 15th edition *by* Verderber, Sellnow and Verderber.
2. Audio-Visual (A-V) aid material (It will be required to use presentation software in class.)
3. Speech outline required for MOST speeches
4. 1 inch 3 ring binder with a little paper (optional)
5. 3x5 index cards for speech notes

Course Description
This course will assist students through an integrated study of theory and practice to be more competent in oral communication situations. Emphasis will be placed on student preparation and presentation of various types of speeches. This course satisfies the requirement for teacher certification in Arkansas public schools. This course requires at least one paper using a documentation format. (ACTS: SPCH1003) (Offered fall and spring semester)

Program Outcomes
This course is designed to develop confidence in the student's ability to communicate effectively. Students will demonstrate the following competencies:

*Critical thinking and listening skills
*Research and organizational skills
*Verbal and non-verbal presentation skills
*Knowledge of oral communication theory
*Understanding diversity in society

Motivational Speech
Newscast/Radio Broadcast
Narrative
Speech to inform
Speech to demonstrate
Speech to persuade
Ceremonial Speech
Group Speech

3. Students will write a positive evaluation and a critical evaluation for each speaker. Comments will be typed up and given to students in addition to my comments after speeches are presented.
4. Students will use note cards as an aid while presenting speeches. In most cases, no full paper notes may be used.
5. Speech outlines will be needed for each speech except for the Impromptu Speeches.

The Grading Scale

90%-100%	A
80%-89%	B
70%-79%	C
60%-69%	D
59% or below	F

Grade Breakdown

Speech Performance (Special Project)	30%
Speech outlines & Aud Adaptation (Homework)	30%
Critiques (Participation)	10%
In-class exercises/participation (Classwork)	15%
Quizzes, unit tests (Tests)	15%
Total	**100%**

Explanation of Assessment Tools

1. **Index cards**

   The Index cards are to be used for notes while presenting speeches. All index cards will be turned in. These SHOULD NOT have your speech written word-for-word. It should only represent highlights, reminders, quotes, etc. If any part of your speech other than a quote is written word-for-word your notecards will receive a zero score.

2. Outline of Speech

(1) The outline is due the day speech presentations begin.
(2) Typed outlines will be submitted at the beginning of class on due date.
(3) Hand written outlines will not be accepted

Conclusion	Provided a transition into the conclusion Summarized main points Ended with a memorable final thought

3. **Reference Sources**
   Reference sources for the bibliography can be found from the computer catalog, encyclopedias, yearbooks, indexes, biographical dictionaries, special dictionaries, quotations, government publications, computer-assisted research, & interviews. No references sources are needed for the Impromptu speeches. One reference source will be needed for the Ceremonial speech and the Newscast. A minimum of three reference sources are needed for the Demonstration, Informative, and Persuasive speeches. An inferior outline will have points deducted. **Be sure all sources are credible**

Semester Calendar
Please follow the MHS as well as the UARM calendar for breaks, testing periods, and weather days.

Attendance/Tardy Policy
Student participation is an extremely important for SPC 203, therefore, punctuality and class attendance are absolutely necessary. We will follow the Attendance and Tardy policies for Mena High School as stated in the MHS Handbook.

It is important to give your speech on the assigned day to make sure that there is an adequate amount of time for all of the speakers. If you are positive that you will not be in class on a speech day, you will need to sign up for the day that you will be in class. Each student will be allowed to make-up one speech. It is to the advantage of the student to be prepared for each speech and not to plan on using the make-up day. A student will receive the grade of "0" if the student is in class and chooses not to speak (for whatever reason). Being absent is not an excuse for not being prepared for any assignment including speeches/exams. If you miss your speech day, be prepared to present the day you return or you will receive a 0 (zero). The student will need to contact the instructor prior to missing any test in case of illness or emergency.

Cell Phones and Texting
Students will not be able to use cell phones or text during class time unless it is permitted by the instructor for a specific assignment. We will follow the Mena High School cell phone policy as stated in the MHS Handbook.

Inclement Weather Procedure
Listen to local radio and TV stations for UARM/MHS closing info in case of bad weather. If a test or speech is assigned for the day the college/high school is closed, they will be due the next time the class meets. Listen to the announcements for details regarding bad weather or go to the college website: www.uarichmountain.edu

Course Calendar
(*Tentative*)

DATE	LESSON COVERED
Jan 6 – 10 Speech: Introductions	Welcome, Class Procedures, Syllabus
	Chapter 1: Foundations of Public Speaking TO DO Public Speaking Strengths and Weaknesses Public Speaking Effectiveness Model Define and Identify Acts of Plagiarism Quiz
Jan 13 – 17 Speech: Impromptu - General	Chapter 2: Developing Confidence through the Speech-Planning Process TO DO Narrative Speech Questions Public Speaking Apprehension in film Research Public Speaking Apprehension & Cures Introduce a Classmate Quiz
	Chapter 3: Listening and Responding Effectively TO DO Listening Activity – Log 2 conversations (Homework) Who Am I? Listening Problems Why is Listening Important Team Listening Challenge Quiz
Jan 20 – 24 Speeches: Impromptu – Credibility Newscast	Chapter 4: Selecting an Appropriate Speech Goal TO DO Audience Analysis http://www.ljlseminars.com/audience.htm Brainstorm, Concept Map, Adapt to Audience Create a General and Specific Goal Quiz
	Chapter 5: Adapting to Audiences TO DO The President's Audience Adapting to All Types Battle of the Sexes Audience Adaptation Plan form Quiz
Jan 27 – 31 Speech - Narrative	Chapter 6: Gathering and Evaluating Information TO DO Reliable Source? Fact Finder Verbal Citations Quiz
Feb 3 - 7	Chapter 7: Organizing and Outlining the Speech Body TO DO Outline vs Notes Main Points and Thesis Statement Evaluate a Famous Speech (Main points)

	I Deserve It ☺ *Impromptu – Sell What You Can* Quiz
	Chapter 14: Persuasive Speaking TO DO Negative vs Positive Persuasion Word Choice and Persuasion Quiz
Mar 23 – 27	Spring Break
Mar 30 – Apr 3	Persuasive Speech
Apr 13 – 17 <u>Speeches</u> – Ceremonial	Chapter 15: Ceremonial Speaking: Speeches for Special Occasions Quiz
Apr 20 - 24	Chapter 16: Developing and Delivering Group Presentations Prepare Group Speech
Apr 27 – May 1 Speech – Group 4/28	Continue Group Speeches Quiz College Lesson
May 4 - 19	College Prep Unit – Cost, Degree choice and Schedule
May 8	BONUS Speech DUE
May 20 - 22	Semester Tests
1st day of speeches	Speech Outlines, Adaptation Plans, PowerPoint
With speeches	Index Cards

This is the pretest (test 1) for Art Appreciation 01 from the first week of school as compared to the test after the first four weeks of school with lecture, quizzes, study guides and reviews. The first average was 31.4% and the revised average for the real test 1 was 74.8%.

Robby Burt

2-10-2020

Participants

Art Appreciation - Spring 2020

January 13 - 20

January 21 - 27

January 28 - February 3

February 4 - 10

Week 4 Goals, Ancient Rome Study Guide, and Test 1...

Art Test #1

Art Test #1

Rome dvd quiz (10 points)

Art of Eternity, The Glory of Byzantium quiz (10 p...

Art of Eternity - Glory of Byzantium Youtube

Chapter 9 Powerpoint

Ancient Rome

Temple of Portunus

Pantheon

Augustus of Primaporta

Ara Pacis

Colosseum

Arch of Titus

Column of Trajan

Equestrian sculpture of

Next ▶

Step	Time	Act
2	15/01/20, 12:31	Saved Const
3	**15/01/20, 12:47**	**Atter finisl**

First name / Surname	Email address	State	Started on	Completed	Time taken	Grade/100.00	Q. /1.
Overall average						74.88 (31)	0.9

Select all / Deselect all Regrade selected attempts Delete selected attempts

Page: 1 2 (Next)

Overall number of students achieving grade ranges

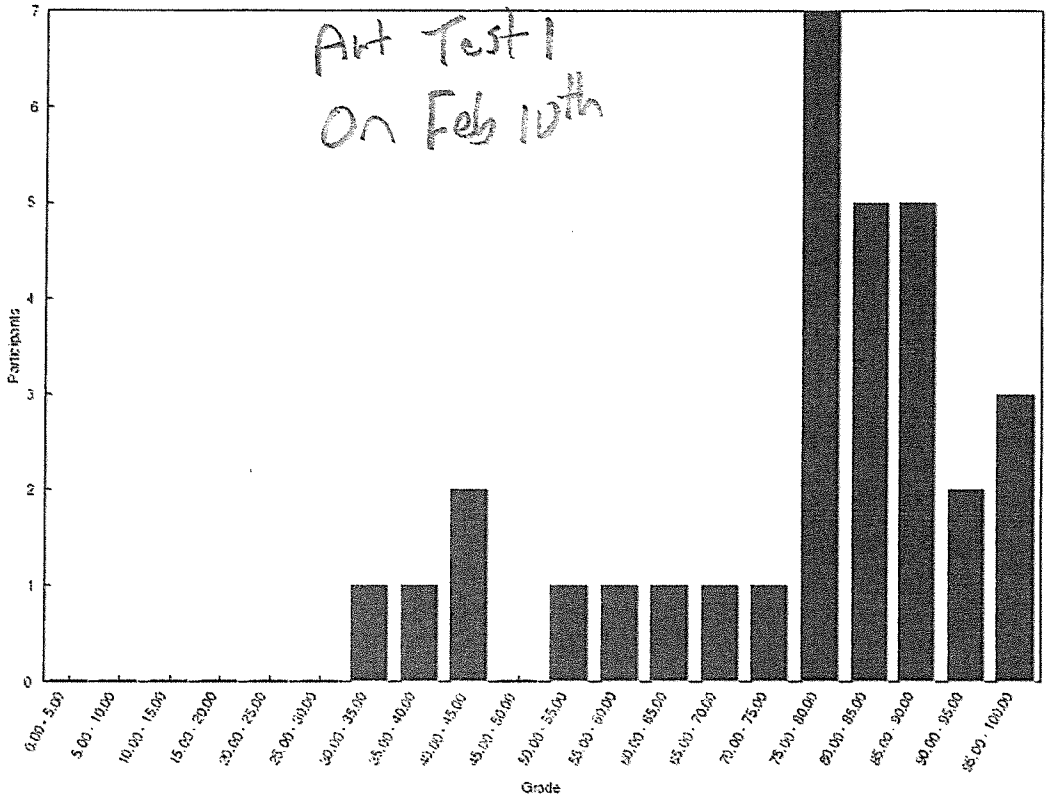

English Comp. II Pretest Name _____

10X 1. A minor writer who deals with the unique characters, speech, and mannerisms of a particular locale.

A. social critic
B. local colorist
C. satirist
D. propagandist

A 2. This belongs to the writer, what the author intends to say

A. meaning
B. analysis
C. explication
D. summary

B 3. Omissions in the story; things left unsaid.

A. blanks
B. gaps
C. indeterminacies
D. conjectures

10X 4. According to your book, the definition of an argument is "A connected series of statements or reasons intended to establish a position; a process of _____."

A. reasoning
B. irrationality
C. incoherency
D. dispute

10X 5. Which of the following is a component of the classic plot line that contains the most intense point in the action?

A. exposition
B. resolution
C. climax
D. rising action

10 11. Which of the following is a parable?

A. Birds of a feather flock together.
B. "The Mexican Fisherman"
C. "The Two Goats"
D. "The Town Mouse and the Country Mouse"

10 12. Which of the following is not a term for a many-sided character?

A. static
B. complex
C. dynamic
D. round

C 13. Passages left open to various interpretations.

A. meanings
B. mysteries
C. indeterminancies
D. gaps

10 14. All of the following are expected in an academic, literary essay EXCEPT _____.

A. evidence based
B. clearly written argument
C. good grammar
D. summary of the entire plot

10 15. What is the method used to separate a longer piece of literature into parts in order to understand the whole?

A. paraphrasing
B. summarizing
C. explication
D. analysis

21. Who is renowned for revolutionizing the Gothic Revival?

A. Horace Walpole
B. Mary Shelley
C. William Beckford
D. Bram Stoker

22. The Gothic Revival started where?

A. ruins
B. gardens
C. churches
D. castles

23. Gothic literature draws its name from what?

A. The setting of the first Gothic novel was in Goth, Germany.
B. The Germanic tribe, the Goths
C. The architectural style of medieval castles
D. The name of the first protagonist of Gothic literature was Goth.

24. What is the most common theme found in science-fiction literature?

A. Faith versus doubt
B. The dangers of technology
C. Desire to escape
D. Love and sacrifice

25. How were Sci-fi stories published in the Golden Age?

A. Published as a normal book
B. A series of stories published in magazines over a period of time
C. They are traditionally oral stories.
D. Published as anthologies

26. What is credited as the first mystery story written?

A. The Hardy Boys
B. *The Adventures of Sherlock Holmes*
C. "The Murders in the Rue Morgue"
D. *Murder on the Orient Express*

10K 34. In an essay analyzing a single work, the proper in-text citation is….

A. None (no citation needed because the work is named in the introduction)

B. (Smith 276) -- Author's last name and page number

C. (276) -- Only the page number

D. (pg. 276)

E. (Smith pg. 276)

10K
35. Circle all of the following that are rules of Courtly Love.

A. Be platonic

B. Married ladies should have affairs.

C. Be secret.

D. Suffer lovesickness

E. Remain aloof

10K
36. Circle all of the following that can be found in an exposition?

A. Necessary background information

B. Setting

C. Characters

D. Atmosphere

E. Complications arising from conflict

F. Source of conflict

10K
37. Circle all of the following that are characteristics of Gothic Fiction?

A. Supernatural events

B. Archaic language

C. Gloomy atmosphere

D. Madness

E. Futuristic setting

F. Mysterious characters

G. Death

Pretest for English Composition II

Student Name: _____

Circle the correct answer.

1. What is the term for a writer who brings to light concerns over power, politics, and agency to problems?
   a. Local Colorist
   b. Literary Critic
   c. Historical Analyst
   d. Social Critic
2. In "Desiree's Baby," Kate Chopin took a critical review of what issue?
   a. Slavery
   b. The Holocaust
   c. World War I
   d. Single parents
3. In "Terrible Things," anthropomorphism is used to tell what the story of what?
   a. The birth of America
   b. Slavery
   c. The Holocaust
   d. World War I
4. *All Systems Red* focuses on what?
   a. The history of technology
   b. The humanity of a robot
   c. The dangers of a segregated society
   d. The theme of control
5. *Murder on the Orient Express* emphasizes what?
   a. The racism that existed in the early-20th century
   b. The dangers of a female traveling alone by train in a foreign country
   c. The beginning of the technological era in the U.S.
   d. The repercussions of the tragic loss of a child
6. Which of the following is the correct punctuation for a quotation within a quotation?
   a. "The woman bowed her turbaned head majestically, "Mais si, Madame.""
   b. "The woman bowed her turbaned head majestically, 'Mais si, Madame.'"
   c. 'The woman bowed her turbaned head majestically, "Mais si, Madame."'
   d. "The woman bowed her turbaned head majestically, 'Mais si, Madame.'"
7. Which of the following uses the correct verb for a literary analysis essay?
   a. Roth portrays Beatrice as a weak character before developing her into the strong fem Tris.
   b. Roth portrayed Beatrice as a weak character before developing her into a strong fema Tris.
   c. Beatrice is portrayed as a weak character and then developed into a strong female ch
   d. The portrayal of Beatrice as a weak character before developing her into the strong fe Tris.
8. Which of the following statements is the BEST written for a literary analysis paper?
   a. I think Mathilde is very vain.
   b. Mathilde might be vain.
   c. Mathilde is vain.
   d. I believe Mathilde is vain.

37. A product of glycolysis is
   A. ethyl alcohol.
   B. lactic acid.
   C. pyruvate.
   D. oxygen.
   E. acetyl-CoA

38. Where in the cell does glycolysis occur?
   A. Cytoplasm
   B. Mitochondrion
   C. matrix of mitochondrion
   D. cristae of mitochondrion
   E. nucleus

39. The figure below shows a cell in the mitotic stage of.....
   A. anaphase.
   B. interphase.
   C. metaphase.
   D. prophase.
   E. telophase.

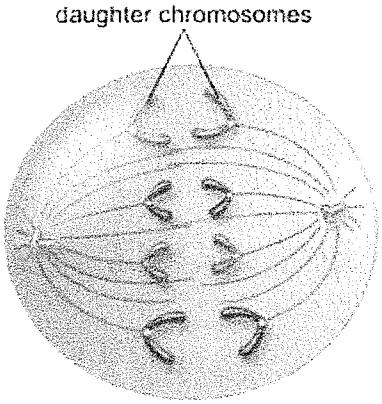

40. When several genes influence a character
   A. polygenic character
   B. Pleotropic
   C. Contrasting character
   D. Back-cross
   E. Test-cross

Nath

Biology: **Pre- and post -Test Spring 2020**

Name: ____ _____ _____

1. **All of the following are true with respect to DNA except**
   A. genes are made up of DNA.
   B. all of your body cells share the same DNA (with the exception of egg and sperm cells).
   C. DNA is a double-helix.
   D. all of your body cells share the same DNA.
   E. DNA provides instructions for making proteins.
2. **The only single-celled organisms are prokaryotes, such as archaea and bacteria.**
   A. True because prokaryotes are the simplest cell form.
   B. True because all eukaryotes are multicellular.
   C. False because some eukaryotes, including protista, are single-celled.
   D. False because some prokaryotes are multicellular.
   E. False because all single-celled organisms are prokaryotes.
3. **Based on the evolutionary tree of the three domains, which of the following is true?**
   A. All three domains have a common ancestor.
   B. Domain Bacteria and domain Eukarya are more closely related to each other than to domain Archaea.
   C. The Eukarya have remained the same throughout evolutionary time.
   D. All three domains are equally related to one another.
   E. The Eukarya are the common ancestors to the three domains.
   All three domains have a common ancestor.
4. **Which of the following correctly lists the classification categories from least to most inclusive?**
   A. kingdom, phylum, domain, class, order family, genus, species
   B. domain, kingdom, class, order, family, phylum, genus, species
   C. species, genus, family, class, order, domain, phylum, kingdom
   D. species, genus, family, order, class, phylum, kingdom, domain
   E. phylum, species, genus, kingdom, domain, order, class, family
5. **Inside the chloroplasts, chlorophyll is found in the**
   A. mesophyll.
   B. thylakoid space.
   C. thylakoid membrane.
   D. stroma.
   E. cytoplasm.
6. The **enzyme-rich solution found within the chloroplast is called the**
   A. granum.
   B. chlorophyll.
   C. cytoplasm.
   D. stroma.
   E. Christae

14. What molecule most directly provides the energy you need for your muscles to contract?

A. glucose
B. ATP
C. NADH
D. ADP
E. oxygen

15. What organelle is used during the process of cellular respiration?

A. Nucleus
B. mitochondria
C. chloroplast
D. ribosomes
E. cell membrane

16. What cellular process uses oxygen to break food down, producing ATP?

A. photosynthesis
B. oxidation/reduction reactions
C. cellular respiration
D. mitosis
E. meiosis

17. Illustrated Figure below, part Y represents which part of a mitochondrion?

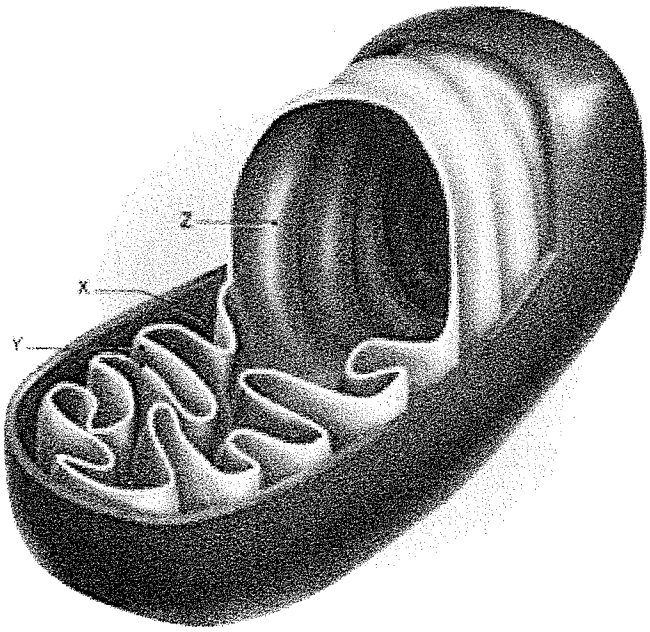

A. outer mitochondrial membrane
B. cristae
C. mitochondrial matrix
D. intermembrane space
E. thylakoids

23. If an organism's DNA contains 20% adenine nucleotides, what percentage of its DNA is composed of thymine nucleotides?

A. 10%
B. 15%
C. 20%
D. 30%
E. 40%

24. Which of the following processes does not occur within the nucleus?

A. DNA replication
B. transcription
C. intron removal
D. translation
E. primary mRNA splicing

25. The sequence of the mRNA that would result from transcribing the gene pictured would be

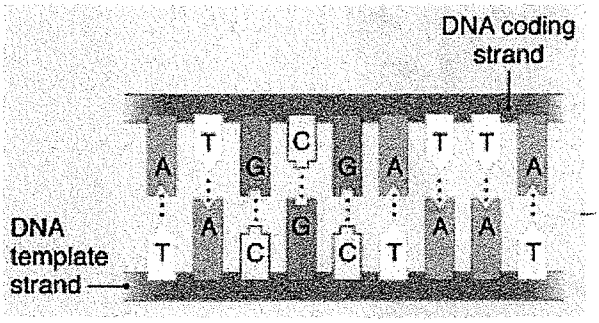

A. AUGCGAUUA.
B. AUUAGCGUA.
C. UACGCUAAU.
D. UAAUCGCAU.
E. ATGCGATTA.

26. The sequence of the peptide that would result from transcribing and translating the gene pictured would be

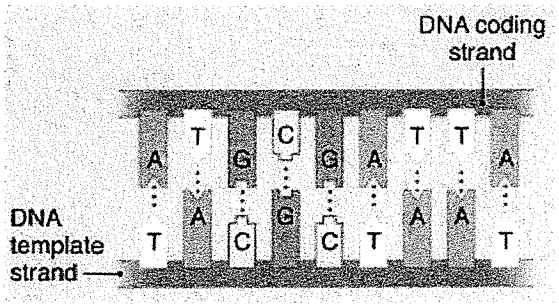

A. Tyr-Ala-Asn.
B. Ile-Ser-Val.
C. no peptide would be made; the first codon means "stop."
D. Met-Arg-Leu.
E. Tyr-Ser-Val.

30. **Refer to the figure. Which of the following is true regarding the labeled plasma membrane?**

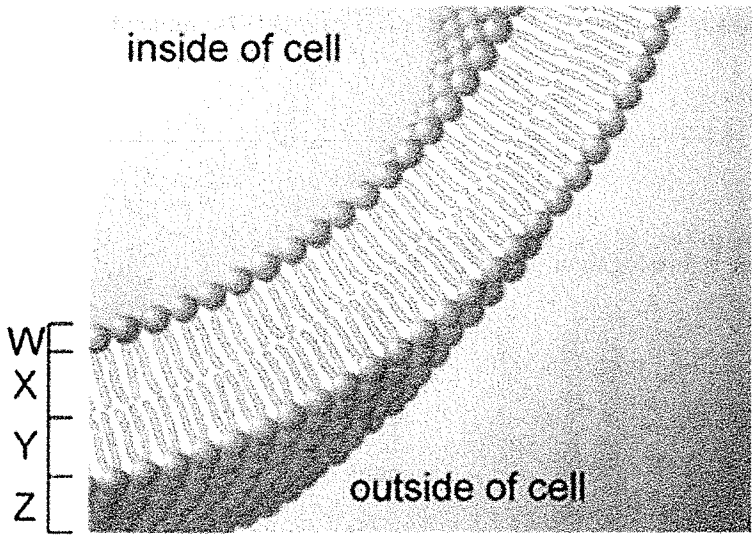

A. Parts X and Z are hydrophobic.
B. Parts W and Z are hydrophilic.
C. Parts X and Y are hydrophilic.
D. Parts W and Y are hydrophobic.
E. Parts W and X are hydrophilic.

31. Nuclear division is represented in the figure below by the letter

A. a.
B. b.
C. c.
D. d.
E. e.

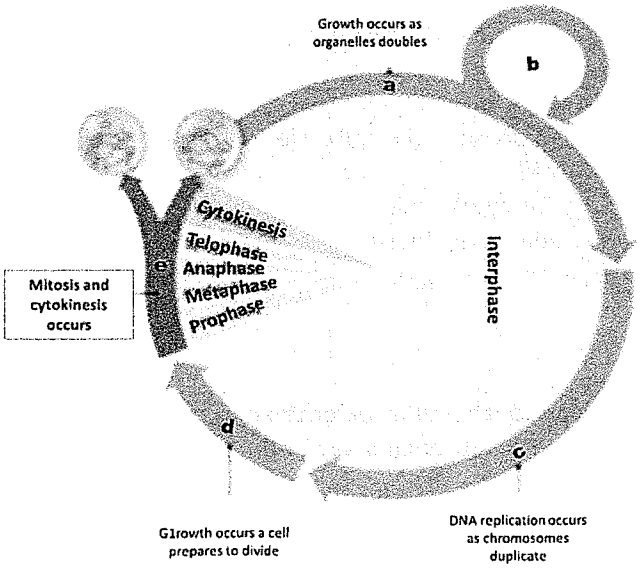

37. A product of glycolysis is
   A. ethyl alcohol.
   B. lactic acid.
   C. pyruvate.
   D. oxygen.
   E. acetyl-CoA

38. Where in the cell does glycolysis occur?
   A. Cytoplasm
   B. Mitochondrion
   C. matrix of mitochondrion
   D. cristae of mitochondrion
   E. nucleus

39. The figure below shows a cell in the mitotic stage of.....
   A. anaphase.
   B. interphase.
   C. metaphase.
   D. prophase.
   E. telophase.

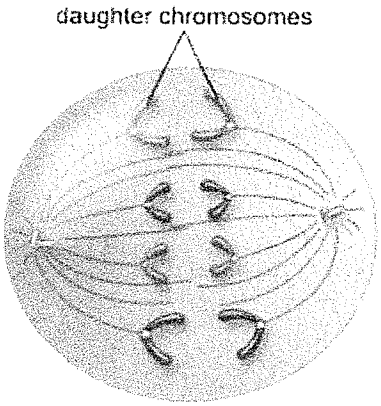

40. When several genes influence a character
   A. polygenic character
   B. Pleotropic
   C. Contrasting character
   D. Back-cross
   E. Test-cross

Rowland

9/20

Physical Science Pre-Test

Name: _____ _____

Directions: Complete each question and show work where appropriate. Highlight your answer in some fashion.

X 1. Which of the following is NOT a fundamental property?
   a. Length
   b. Time
   c. Color
   d. Mass

2. A 5 km length is the same as how many meters?
   a. 0.005 m
   b. 0.05 m
   c. 500 m
   d. 5,000 m

3. Velocity describes
   a. Speed
   b. Direction
   c. Speed and Direction
   d. Acceleration

4. The density of ice is _____ than the density of liquid water, proven by the fact that ice floats on water
   a. The same
   b. Less
   c. More

X 5. Acceleration can be a negative quantity (True or False)

6. _____ energy is the energy due to position.
   a. Kinetic
   b. Potential
   c. Both of the above
   d. None of the above

7. Which element is NOT a diatomic?
   a. Oxygen
   b. Nitrogen
   c. Magnesium
   d. Hydrogen

16. Who is credited with the discovery of the nucleus and the existence of protons?
   a. Thomson
   b. Millikan
   c. Rutherford
   d. Bohr

17. The atomic number is the number of _____ in an element.
   a. Protons
   b. Neutrons
   c. Electrons
   d. Protons + neutrons

18. Which quantum number describes the main energy level?
   a. 1st (n), principal
   b. 2nd (l), angular momentum
   c. 3rd (m), magnetic
   d. 4th, spin

19. The elements in group 1 are known as the _____.
   a. Alkaline earth metals
   b. Noble gases
   c. Halogens
   d. Alkali metals

20. How many valence electrons does chlorine have?
   a. 1
   b. 6
   c. 7
   d. 8

Sherrer

46%

Pre-test MTH 223-01 NS II **Nam**[redacted]

Score 5.5/12 **Date** 1/15/2020

+1 **1.** The length of a rectangular garden is 3 feet less than 5 times the width. If *w* is the width, write the expression for the length in terms of *w*. 5w - 3

+1 **2.** Determine the mode for the following set of numbers. 24, 32, 44, 32, 16, 24, 50, 24
Write the mode and explain why that is your answer. 24
It's the number that is most frequent number.

3. A technology company founder buys an estate in California for three times the previously highest recorded sale price of any property. Which statewide housing market statistic will be most affected? Choose one and defend your answer.

Range Median Mode Mean

It will change the average cost of the housing market. or raise

4. Draw a box-and-whisker plot for the following test scores in an Algebra class. Include an asterisk (*) for the outlier.

Test scores: 99, 60, 97, 73, 95, 74, 81, 81, 82, 94, 92, 90, 86, 83, 84

It's been too long since I have done one in time.

+1 **5.** What is the difference between a pie chart and an exploding pie chart? Write your answer or draw and label to explain.

pie chart (info inside)

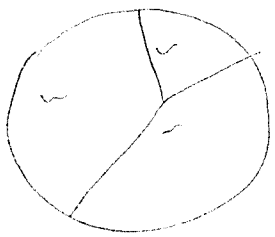

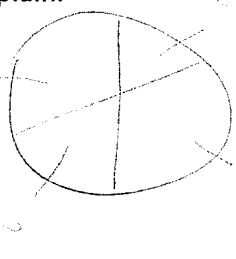

exploding pie chart (info outside)

6. If you were to flip a coin three times, what would the probability be that you would flip tails two of the three times? Diagram and write your answer.

I don't know.

Sherrek

6%

Pre-test MTH 223-01 NS II

Score .75 / 12

Name [redacted]

Date 1/13/20

1. The length of a rectangular garden is 3 feet less than 5 times the width. If *w* is the width, write the expression for the length in terms of *w*. _____

3 − 5W

.5

2. Determine the mode for the following set of numbers. 24, 32, 44, 32, 16, 24, 50, 24
Write the mode and explain why that is your answer.

24

3. A technology company founder buys an estate in California for three times the previously highest recorded sale price of any property. Which statewide housing market statistic will be most affected? Choose one and defend your answer.

Range Median Mode Mean

4. Draw a box-and-whisker plot for the following test scores in an Algebra class. Include an asterisk (*) for the outlier.

Test scores: 99, 60, 97, 73, 95, 74, 81, 81, 82, 94, 92, 90, 86, 83, 84

IDK

5. What is the difference between a pie chart and an exploding pie chart? Write your answer or draw and label to explain.

IDK

6. If you were to flip a coin three times, what would the probability be that you would flip tails two of the three times? Diagram and write your answer.

IDK

Weldo

Technical Math Pre/Post Test

Name _____ Date 1-14-20

MULTIPLE CHOICE. Choose the one alternative that best completes the statement or answers the question.

1) Convert the mixed number to an improper fraction. $3\frac{5}{6}$ 1) C

A) $\frac{7}{3}$ B) $\frac{23}{6}$ C) $\frac{25}{6}$ D) $\frac{19}{2}$

2) Convert the improper fraction to a mixed number. $\frac{16}{7}$ 2) C

A) $2\frac{1}{8}$ B) $7\frac{1}{16}$ C) $16\frac{1}{7}$ D) $2\frac{2}{7}$

3) Reduce the fraction to the lowest terms. $\frac{406}{1,204}$ 3) B

A) $\frac{29}{86}$ B) $\frac{406}{86}$ C) $\frac{203}{602}$ D) $\frac{29}{1,204}$

SHORT ANSWER. Write the word or phrase that best completes each statement or answers the question.

4) Add and reduce the answer to lowest terms. $\frac{1}{3} + \frac{1}{4}$ 4) 2/7

5) Subtract and reduce the answer to lowest terms. $\frac{1}{12} - \frac{7}{8}$ 5) 5/4

6) Multiply and reduce the answer to lowest terms. $\frac{2}{7} \times -\frac{9}{20}$ 6) 1/63

7) Divide and reduce the answer to lowest terms. $-\frac{7}{24} \div \frac{7}{8}$ 7) 1/4

8) Solve the proportion. $\frac{9}{1} = \frac{36}{x}$ 8) illegible

MULTIPLE CHOICE. Choose the one alternative that best completes the statement or answers the question.

14) Use the Pythagorean theorem to find the measure of side x. 14) _____

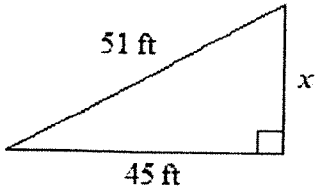

A) 24 ft B) 18 ft C) 68 ft D) 10 ft

15) Find the area. 15) _____

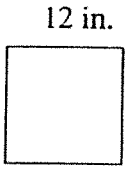

A) 24 in^2 B) 12 in^2 C) 48 in^2 D) 144 in^2

16) Find the area. 16) _____

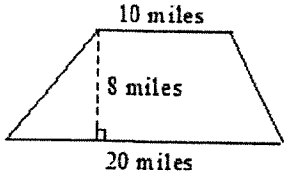

A) 120 $miles^2$ B) 160 $miles^2$ C) 80 $miles^2$ D) 240 $miles^2$

SHORT ANSWER. Write the word or phrase that best completes each statement or answers the question.

17) Find the area of the circle. Use $\pi = 3.14$. 17) _____

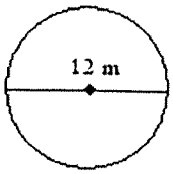

20) Suppose the cone below has a radius of 5 inches and a height of 10 inches. Find the volume of the cone. Round to two decimal places. Use 3.14 for π. 20) _____

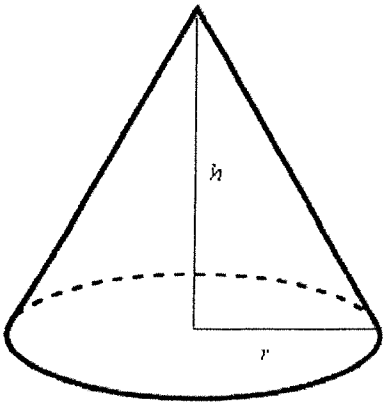

A) 261.8 in^3 B) 157.08 in^3 C) 104.72 in^3 D) 392.7 in^3

Billingsley

Practice Questions

1. The amount of adult supervision that is needed depends on
   a. the number of children in the group.
   b. the activity.
   c. the developmental needs of children who are present.
   d. all of these.

D

2. The first-aid kit should be kept
   a. out of the reach of children.
   b. in an easily accessible location, clearly marked, and out of the reach of children.
   c. in a restroom.
   d. in a drawer, far from where children will play.

B

3. Frequent hand washing is important because
   a. children need to keep hands clean.
   b. it keeps germs from spreading.
   c. it is a positive social skill.
   d. it is a law.

B

23/30 76%

4. An open-ended question
   a. has one right answer.
   b. has no right or wrong answer.
   c. has two answers.
   d. has a commonly repeated answer.

B

5. Children should be provided with these items for washing their hands:
   a. Cold water, bar soap, and paper towels
   b. Hot water, liquid soap, and a cloth towel
   c. Warm water, liquid soap, and paper towels
   d. Water and paper towels

C

6. Children need their own space in the classroom for their coat and other belongings because
   a. it promotes their positive self-concept.
   b. it helps maintain good health.
   c. a and b.
   d. none of the above.

7. An example of a positive *nonverbal* communication is
   a. a smile.
   b. saying, "Good morning."
   c. ignoring a child's actions.
   d. moving away from a child.

8. At mealtime, a caregiver should
   a. insist that children finish all food on their plates.
   b. not offer any dessert until all their food is finished.
   c. only offer dessert to the children who remained quiet at the table while eating.
   d. none of the above.

9. When arranging a classroom, a teacher should
   a. keep the quiet and noisy activities together.
   b. put related activities near each other.
   c. provide a large, open area in the center of the room.
   d. arrange the furniture all along the walls.

10. The best example of an open-ended material would be
    a. an alphabet puzzle.
    b. playdough and cookie cutters.
    c. a coloring book and crayons.
    d. unit blocks.

11. The children have been asking for the same book to be read at story time every day for the past week. You will
    a. happily reread it, because you know children benefit from repetition.
    b. read a book that is similar to the one they enjoy.
    c. tell the children that they have heard that book too many times and will need to choose a new one.
    d. skip story time for a few days until they have forgotten about that book.

12. Children's play materials should be
   a. kept in closed containers.
   b. kept on low, open shelves.
   c. kept on shelves out of their reach.
   d. kept in a storage cabinet, to be taken out by the caregiver.

B

13. A developmentally appropriate group time
   a. lasts only a short time.
   b. gets the children actively involved.
   c. permits children to leave, if they wish.
   d. all of the above.

B

14. Why do you give children a warning before activities are about to change?
   a. It gives them time to clean up their toys.
   b. It provides them time to finish up an activity.
   c. It helps to quickly get their attention.
   d. It is a signal to come to the next activity right away.

B

15. You want children to learn the rules of conversation, so you
   a. give them practice talking, listening, and responding in casual conversation as you sit with them at the lunch table.
   b. let them know they cannot talk during lunch.
   c. tell them not to interrupt while you are talking.
   d. remind the children to use "inside voices."

A

16. A good early childhood practice is
   a. having the children line up to use the restroom.
   b. having the children sit outside the restroom to wait for their turn.
   c. having the children all do an art activity together.
   d. asking the children to pretend to be butterflies as they walk to the playground.

D

17. An activity that develops small-motor skills would be
   a. swinging.
   b. beanbag throwing.
   c. bead stringing.
   d. jumping.

C

18. An activity that develops small-motor skills would be

a. manipulating playdough.

b. walking on a balance beam.

c. throwing a ball.

d. riding a tricycle.

B

19. You have a small budget to use for purchasing materials for your classroom. When choosing, you will first consider

a. the price and how much you can buy with what you have.

b. the age range listed on the packaging.

c. whether the materials are developmentally appropriate, are mostly open-ended, and will enable the children to experience success.

d. whether the materials are familiar to the children from TV commercials.

C

20. Two boys want the same truck to haul blocks across the room. One boy goes to the housekeeping area and gets a basket. This is an example of

a. an open-ended question.

b. problem solving.

c. a small-motor exercise.

d. guidance.

B

21. When talking with a child, the caregiver should

a. speak loudly.

b. get down to the child's eye level.

c. whisper softly to the child.

d. stand and talk with the child.

B

22. Caregivers should

a. control the conversations that children have with them.

b. be good listeners.

c. ask a lot of open-ended questions.

d. b and c.

D

23. You want the children to learn cooperation, so you
   a. insist that a child let everyone play with the toy he brought for show-and-tell.
   b. discipline the children for not helping pick up the toys in the room.
   c. play a song about cooperation.
   d. provide activities that require taking turns, sharing materials, and solving problems together.

D

24. Children's artwork should be
   a. put on bulletin boards in the hallways.
   b. placed high on walls so other children cannot touch it.
   c. displayed at the children's eye level.
   d. put immediately into the children's cubbies to be taken home.

C

25. A creative arts project is
   a. marble painting on turkey shapes.
   b. painting at the easel on pumpkin-shaped paper with orange and black paint.
   c. painting with orange and black paint on white paper.
   d. sponge painting on a white ghost shape.

B

26. One of the children is having a tantrum just as circle time is beginning. The best way to proceed would be to
   a. stay close to the child and explain to the others that she is having a hard time right now but will be all right in a few minutes. Let your co-teacher start the circle time.
   b. call her parents to take her home.
   c. take her to the director's office until she calms down.
   d. have the child sit in the time-out chair until she can control her emotions and return to the group.

A

27. A creative activity is
   a. cooking using a recipe.
   b. stringing beads.
   c. using playdough.
   d. assembling a twenty-piece puzzle.

A

28. Which activity is creative?

a. Using a CD that tells children how to move

b. Dancing with scarves to an instrumental CD

c. Using musical instruments with a CD that tells children when to play them

d. Singing "Where is Thumbkin?"

29. A good technique for dealing with favorite toys is to

a. provide duplicates of them.

b. put them away when children squabble over them.

c. provide them as rewards for good behavior.

d. none of the above.

30. You are aware that many of the children watch a great deal of TV and videos at home. You would like the parents to support their children's development at home instead of relying on screen media. You will

a. confront the parents at drop-off time about the detrimental effects of too much screen time for young children.

b. send home a listing of suggested TV shows and children's videos.

c. send home book and activity packs that the children can enjoy with their families.

d. send home an educational video each Friday.

Colby Singleton

Pretest for English Composition II

5/10

Student Name [redacted]

Circle the correct answer.

1. What is the term for a writer who brings to light concerns over power, politics, and agency to draw awareness to problems?
   a. Local Colorist
   b. Literary Critic
   c. Historical Analyst
   d. Social Critic
2. In "Desiree's Baby," Kate Chopin took a critical review of what issue?
   a. Slavery
   b. The Holocaust
   c. World War I
   d. Single parents
3. In "Terrible Things," anthropomorphism is used to tell what the story of what?
   a. The birth of America
   b. Slavery
   c. The Holocaust
   d. World War I
4. *All Systems Red* focuses on what?
   a. The history of technology
   b. The humanity of a robot
   c. The dangers of a segregated society
   d. The theme of control
5. *Murder on the Orient Express* emphasizes what?
   a. The racism that existed in the early-20th century
   b. The dangers of a female traveling alone by train in a foreign country
   c. The beginning of the technological era in the U.S.
   d. The repercussions of the tragic loss of a child
6. Which of the following is the correct punctuation for a quotation within a quotation?
   a. "The woman bowed her turbaned head majestically, "Mais si, Madame.""
   b. "The woman bowed her turbaned head majestically, 'Mais si, Madame.'"
   c. 'The woman bowed her turbaned head majestically, "Mais si, Madame."'
   d. "The woman bowed her turbaned head majestically, 'Mais si, Madame.'"
7. Which of the following uses the correct verb for a literary analysis essay?
   a. Roth portrays Beatrice as a weak character before developing her into the strong female character as Tris.
   b. Roth portrayed Beatrice as a weak character before developing her into a strong female character as Tris.
   c. Beatrice is portrayed as a weak character and then developed into a strong female character as Tris.
   d. The portrayal of Beatrice as a weak character before developing her into the strong female character as Tris.
8. Which of the following statements is the BEST written for a literary analysis paper?
   a. ~~I think Mathilde is very~~ vain.
   b. ~~Mathilde might~~ be vain.
   c. Mathilde is vain.
   d. I believe Mathilde is vain.

[redacted]

9. According to MLA 8, which of the following is the MOST preferred in-text citation for a printed book in an essay where multiple books are cited?
   a. In the story, Richard Bach writes, "For most gulls, it is not flying that matters, but eating" (Bach 4).
   b. Johnathan Livingston Seagull says, "For most gulls, it is not flying that matters, but eating" (4).
   c. "For most gulls, it is not flying that matters, but eating," writes Richard Bach (Bach 4).
   d. In the story, Richard Bach writes, "For most gulls, it is not flying that matters, but eating" (4).
10. As a general rule of thumb, when a quotation is longer than _____ lines, the quote should use formatting for a block quotation.
   a. Three
   b. Four
   c. Five
   d. Six

7/25 = 28% Nath

Microbiology: **Pre- and post -Test Spring 2020**

Name: _____ _____

1. **All of the following are true with respect to DNA except**
   A. genes are made up of DNA.
   B. all of your body cells share the same DNA (with the exception of egg and sperm cells).
   C. DNA is a double-helix.
   D. all of your body cells share the same DNA.
   E. DNA provides instructions for making proteins.
2. **When humans manipulate the genes of microorganisms, the process is called**
   A. bioremediation.
   B. genetic engineering.
   C. epidemiology.
   D. immunology.
   E. taxonomy.

3. **The microorganisms that recycle nutrients by breaking down dead matter and wastes are called**
   A. decomposers.
   B. prokaryotes.
   C. pathogens.
   D. eukaryotes.

-1

Decomposers recycle nutrients to the soil or water by breaking down dead matter

4. **Illustrated Figure below, part Y represents which part of a mitochondrion?**

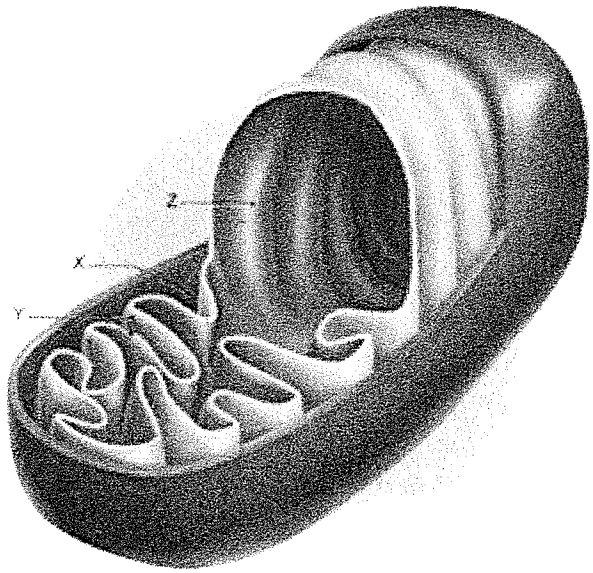

A. outer mitochondrial membrane
B. **cristae**
C. mitochondrial matrix
D. intermembrane space
E. thylakoids

-1

matrix is inside the membrane of mitochondria

11. The sequence of the mRNA that would result from transcribing the gene pictured would be

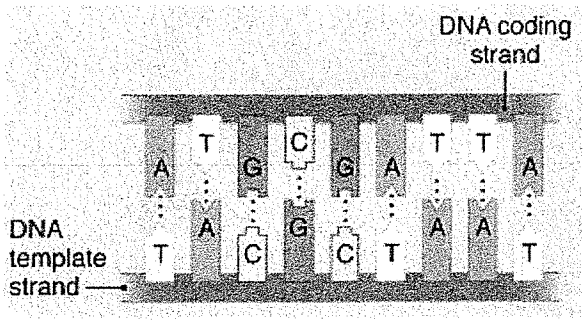

A. AUGCGAUUA.
B. AUUAGCGUA.
C. UACGCUAAU.
D. UAAUCGCAU.
E. ATGCGATTA.

12. The sequence of the peptide that would result from transcribing and translating the gene pictured would be

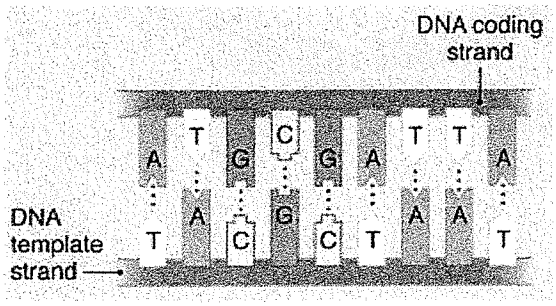

A. Tyr-Ala-Asn.
B. Ile-Ser-Val.
C. no peptide would be made; the first codon means "stop."
D. Met-Arg-Leu.
E. Tyr-Ser-Val.

-1

need to [illegible] the mRNA sequence from the [illegible]

13. Refer to the figure. Which of the following is true regarding the labeled plasma membrane?

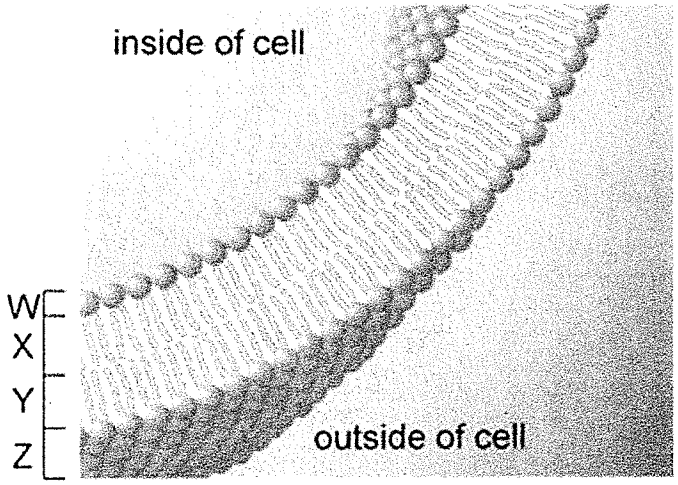

A. Parts X and Z are hydrophobic.
B. Parts W and Z are hydrophilic.
C. Parts X and Y are hydrophilic.
D. Parts W and Y are hydrophobic.
E. Parts W and X are hydrophilic.

-1

X part and Y part

Plasma membrane [illegible] hydrophobic

17. The structures labeled "d" in the figure given in question number 16 are called

A. centromeres.
B. centrioles.
C. sister chromatids.
D. spindles.
E. non-sister chromatids.

18. Susan was examining a cell under the microscope and noticed the formation of a cell plate in the midline of the cell and the formation of nuclei at opposite poles of the cell. The cell under examination was most likely a(n)

A. animal cell in the M phase of the cell cycle.
B. dividing bacterial cell.
C. plant cell undergoing cytokinesis.
D. animal cell undergoing cytokinesis.
E. plant cell in the anaphase stage.

Plant cell makes cell plate during cytokinesis

19. Sam was looking at onion root tip cells under the microscope in his biology lab class. He saw one cell that had two nuclei within it. What stage of the cell cycle was this cell in?

A. anaphase.
B. interphase.
C. metaphase.
D. prophase.
E. telophase/cytokinesis

20. A product of glycolysis is

A. ethyl alcohol.
B. lactic acid.
C. pyruvate.
D. oxygen.
E. acetyl-CoA

21. Where in the cell does glycolysis occur?

A. Cytoplasm
B. Mitochondrion
C. matrix of mitochondrion
D. cristae of mitochondrion
E. nucleus

22. When several genes influence a character

A. polygenic character
B. Pleotropic
C. Contrasting character
D. Back-cross
E. Test-cross

United States History II
Pre-Test

1. Who was the first to use the assembly line in factories?

Henry Ford

2. List one reason why people moved west.

Employment

3. List three tribes of the American Great Plains.

Seminol, Sioux, Cherokee

4. What event led to the beginning of World War I?

Franz Ferdinand Assassination

5. What treaty ended World War I?

Treaty of Versailles

6. What was another name for the 1920s?

Roaring 20's

7. What event began the Great Depression?

Stock Market Crash

8. What brought the US out of the Great Depression?

WWII

9. Who was president when the Depression began and when it ended?

Herbert Hoover — Franklin Roosevelt

10. What event led to US involvement in World War II?

Pearl Harbor

Pretest

Oral Communications

1. One survey of top-level North American executives revealed that _____ believe listening is one of the most important skills needed in the corporate environment.

   a. 40%
   b. 60%
   c. 80%
   d. 100%

2. Nate's mother accused him of not listening to her, but really he was having difficulty _____ her because the television volume was very loud.

   a. paying attention to
   b. attending
   c. hearing
   d. understanding

3. If a listener is allowing his/her mind to drift, over thoughts unrelated to the speech, he/she is _____.

   a. evaluating the speech's effectiveness
   b. silently paraphrasing the information
   c. not attending to the speech
   d. not enjoying the speech

4. If a listener is allowing his/her mind to drift, over thoughts unrelated to the speech, he/she is _____.

   e. evaluating the speech's effectiveness
   f. silently paraphrasing the information
   g. not attending to the speech
   h. not enjoying the speech

T or F

5. A subject is a more specific aspect of a topic. F

6. A good specific goal statement indicates the specific desired audience reaction and allows for many different ideas to be presented. T

7. Brainstorming involves evaluating topics as you list them. T

8. Age, gender and ethnicity are examples of subject-related audience data. T

9. Because it is impossible to know every audience member's attitude toward your topic, it is reasonable to appeal to the majority, as long as you are not stereotyping. F

10. Credibility is an important factor concerning your audience's attitude toward the speaker. T

11. A eulogy is a tribute speech given at a retirement, birthday or anniversary. T

12. An example of a commemorative address would be a speech given on the anniversary of D-Day. T

13. Toasts are expected to last around 6 to 8 minutes. F

14. During a speech of introduction, you should hype the credentials of the person being introduced in order to make them feel special. F

15. It is appropriate in a commencement address to make a political statement and ignore the graduating class. F

16. Highness or lowness of voice describes the _____.

a. pitch
b. volume
c. rate
d. quality

17. Which of the following is NOT an aspect of nonverbal communication?

a. facial expressions
b. eye contact
c. voice articulation
d. words of the speech

24. Besides being intelligible, another reason to fluctuate your pitch during your speech is _____.

a. that some audience members might have hearing losses.
b. that audience members in the back may not be able to hear you.
c. to give time for your audience to process your ideas
d. to avoid accent issues

25. Robert practiced taking a few steps to one side of the stage each time he started a new point of his speech. He is engaging in _____.

a. movement
b. motivated movement
c. gesture
d. audience contact

26. Speaking with no changes in pitch, rate or volume is described as speaking _____.

a. with poor articulation
b. in a monotone
c. impromptu
d. conversationally
e. in a wrong key

27. Spontaneity in speaking means _____.

a. giving the impression that the idea is being formed at the time it is spoken
b. actually talking without extensive preparation
c. memorizing completely
d. varying wording slightly while reading from a manuscript
e. not worrying about what you say

28. A speech that expresses pleasure for the presence of a person or an organization is called a _____.

a. speech of welcome
b. speech of introduction
c. speech of recognition
d. speech of acceptance

Spring 2020 _____ Name

Pre- and Post-Test for

Instructional Technology

1. _____ is the collection of unorganized facts.
2. The _____ are a framework for innovation in education.
   a. Learning how to repair a computer or device.
   b.
   c. Applying existing knowledge to generate new ideas, products, or processes.
3. _____ describes a process in which 2 or more computers or devices transfer data, instruction, and information.
4. _____ created the World Wide Web so computers could share information.
   a. Bill Gates
   b. Steve Jobs
   c. Steve Wozniak
   d. Tim Berners Lee
5. _____ is the world's largest network of businesses, governments, educational institutions, and individuals.
6. A _____ is a collection of data organized in a manner that allows access, retrieval, and use of data.
7. The _____ consists of many electronic components in the system unit that reside on a circuit board.
8. _____ is the place to find the Arkansas competencies for Secondary Teachers: Computer Science, Grades 4-12.
9. _____ consists of programs designed to perform specific tasks for users.
10. _____ is one of the three most popular of Web browsers.
11. _____ is one of the three most popular search engines.
12. _____ was passed to protect children from obscene, pornographic, and other information that is considered harmful.
13. _____ means the original author or creator of the work retains ownership for the work and has exclusive right to reproduce and distribute the created work.
14. _____is a scam in which a perpetrator sends an official-looking email that attempts to obtain personal and financial information.
15. _____ is an unsolicited email message.

You are logged in as Penny Lunsford

Arkansas History

Quiz navigation

1 2 3 4 5 6 7 8 9 10

Finish review

Navigation

- Home
- My home
- Site pages
- My profile
- Current course
  - HIS233
    - Participants
    - General
    - 13 January - 19 January
      - Who are you?
      - Geography of Arkansas
      - Geographical regions of Arkansas
      - **Pre- test**
    - 20 January - 26 January
    - 27 January - 2 February
    - 3 February - 9 February
    - 10 February - 16 February

[redacted]

Started on	Wednesday, 15 January 2020, 10:33 AM
State	Finished
Completed on	Wednesday, 15 January 2020, 10:37 AM
Time taken	4 mins 21 secs
Grade	7 out of 10 (70%)

Question 1

Correct

Mark 1 out of 1

Edit question

Who was the first Spanish Explorer to come into what is now the state of Arkansas?

Select one:

- a. Christopher Columbus
- b. Vasco de Gama
- c. Ferdinand Magellan
- d. Hernando de Soto ✓

The correct answer is: Hernando de Soto

Make comment or override mark

Response history

Step	Time	Acti
1	15/01/20, 10:33	Starte

Administration

- Quiz administration
  - Edit settings
  - Group overrides
  - User overrides
  - Edit quiz
  - Preview
  - Results
  - Locally assigned roles
  - Permissions
  - Check permissions
  - Filters
  - Logs
  - Backup
  - Restore
  - Question bank
- Course administration
- Switch role to...
- My profile settings

17 February - 23 February
24 February - 1 March
2 March - 8 March
9 March - 15 March
16 March - 22 March
23 March - 29 March
30 March - 5 April
6 April - 12 April
13 April - 19 April
20 April - 26 April
27 April - 3 May
4 May - 10 May
11 May - 17 May
My courses

Step	Time	Acti
2	15/01/20, 10:37	Saved Hern de So
3	**15/01/20, 10:37**	**Atter finisl**

Question 2
Correct
Mark 1 out of 1
Edit question

What is the highest mountain in Arkansas?

_____

Select one:

a. Petit Jean
b. Mount Magazine ✓
c. Rich Mountain
d. Boston Mountain

The correct answer is: Mount Magazine

Make comment or override mark

Response history

Step	Time	Acti
1	15/01/20, 10:33	Starte
2	15/01/20, 10:37	Saved Moun Maga
3	**15/01/20, 10:37**	**Atter finisl**

Question 3
Incorrect
Mark 0 out of 1
Edit question

According to the Missouri Compromise, if Arkansas came in as a slave state, another state had to come in as a non-slave state. Which state

came in with Arkansas?

_____

Select one:

a. Michigan

b. Missouri ✗

c. Texas

d. Illinois

The correct answer is: Michigan

Make comment or override mark

Response history

Step	Time	Acti
1	15/01/20, 10:33	Starte
2	15/01/20, 10:37	Saved Misso
3	**15/01/20, 10:37**	**Atter finisl**

Question 4

Correct

Mark 1 out of 1

Edit question

During the Civil War, the majority of people in Arkansas fought on the side of the Confederacy. True or False? ____

Select one:

True ✓

False

The correct answer is 'True'.

Make comment or override mark

Response history

Step	Time	Acti
1	15/01/20, 10:33	Starte
2	15/01/20, 10:37	Saved True
3	**15/01/20, 10:37**	**Atter finisl**

Question 5
Incorrect
Mark 0 out of 1
Edit question

What was discovered in the town of El Dorado, in the 1920s, that would cause the population of that town to greatly increase? _____

Select one:

- a. diamonds
- b. gold
- c. coal
- d. oil

The correct answer is: oil

Make comment or override mark

Response history

Step	Time	Acti
1	15/01/20, 10:33	Starte
2	15/01/20, 10:37	Saved diam(
3	**15/01/20, 10:37**	**Atter finisl**

Question 6
Correct
Mark 1 out of 1

Before the mascot of the University of Arkansas was the Razorbacks, it

Edit question

was the

_____.

Select one:

a. Cardinals

b. Tigers

c. Bluejays

d. Bears

The correct answer is: Cardinals

Make comment or override mark

Response history

Step	Time	Acti
1	15/01/20, 10:33	Starte
2	15/01/20, 10:37	Saved Cardi
3	**15/01/20, 10:37**	**Atter finisl**

Question 7

Incorrect

Mark 0 out of 1

Edit question

What is the name of the oldest bottled water company in the United States (it's from Arkansas)?

_____

Select one:

a. Ozarka

b. Evian

c. Mountain Valley Spring

d. Crystal Springs

The correct answer is:
Mountain Valley Spring

Make comment or override mark

Response history

Step	Time	Acti
1	15/01/20, 10:33	Starte
2	15/01/20, 10:37	Saved Cryst Sprin
3	**15/01/20, 10:37**	**Atter finisl**

Question 8
Correct
Mark 1 out of 1
Edit question

Arkansas has the only diamond mine in the world where people can dig for and keep their own diamonds. True or False? _____

Select one:

- True
- False

The correct answer is 'True'.

Make comment or override mark

Response history

Step	Time	Acti
1	15/01/20, 10:33	Starte
2	15/01/20, 10:37	Saved True

Step	Time	Acti
3	**15/01/20, 10:37**	**Atter finisl**

Question 9
Correct
Mark 1 out of 1
Edit question

Arkansas has which of the following natural resources? _____

Select one:

a. oil

b. coal

c. natural gas

d. all of the above

The correct answer is: all of the above

Make comment or override mark

Response history

Step	Time	Acti
1	15/01/20, 10:33	Starte
2	15/01/20, 10:37	Saved of the above
3	**15/01/20, 10:37**	**Atter finisl**

Question 10
Correct
Mark 1 out of 1
Edit question

Who are the West Memphis Three?

Select one:

a. 3 young boys who were murdered

b. 3 young men accused of murder

c. a rock band

d. 3 famous politicians from Arkansas

The correct answer is: 3 young men accused of murder

Make comment or override mark

Response history

Step	Time	Acti
1	15/01/20, 10:33	Starte
2	15/01/20, 10:37	Saved young men accus of murd
3	**15/01/20, 10:37**	**Atter finisl**

Finish review

Time taken	Grade/10	Q. 1 /1	Q. 2 /1	Q. 3 /1	Q. 4 /1	Q. 5 /1	Q. 6 /1	Q. 7 /1	Q. 8 /1	Q. 9 /1	Q. 10 /1
5 mins 1 sec	10	1	1	1	1	1	1	1	1	1	1
4 mins 21 secs	7	1	1	0	1	0	1	0	1	1	1
1 min 37 secs	6	1	1	0	0	1	1	0	1	1	0
2 mins 39 secs	3	0	0	0	1	0	0	1	1	0	0
3 mins 3 secs	6	1	1	0	1	0	1	0	1	0	1
1 min 16 secs	7	0	1	0	1	1	0	1	1	1	1
4 mins 49 secs	6	0	1	0	1	0	0	1	1	1	1
4 mins 53 secs	7	0	1	1	1	0	0	1	1	1	1
3 mins 21 secs	9	1	1	0	1	1	1	1	1	1	1
5 mins 1 sec	6	1	1	0	1	1	1	0	0	1	0
3 mins 41 secs	8	1	1	0	1	1	0	1	1	1	1
5 mins 1 sec	6	1	1	0	0	0	1	1	1	0	1
-	-	-	-	-	-	-	-	-	-	-	-
2 mins 3 secs	6	1	1	0	1	0	0	0	1	1	1
3 mins	6	0	1	0	1	0	1	1	0	1	1
1 min 20 secs	6	1	0	1	1	0	1	0	1	1	0
3 mins 28 secs	9	0	1	1	1	1	1	1	1	1	1
3 mins 17 secs	9	1	1	0	1	1	1	1	1	1	1
3 mins 35 secs	5	0	1	0	0	1	1	0	1	1	0
3 mins 24 secs	8	1	1	0	1	1	1	0	1	1	1
5 mins	6	1	1	1	1	0	1	0	1 -	-	
3 mins 53 secs	5	1	1	1	0	1	0	0	0	1	0
5 mins 3 secs	9	1	1	0	1	1	1	1	1	1	1
5 mins 1 sec	6	1	1	0	1	0	0	0	1	1	1
5 mins 1 sec	2	1	1 -	-	-	-	-	-	-	-	
1 min 10 secs	6	1	0	1	1	0	0	0	1	1	1
2 mins 34 secs	5	1	1	1	0	0	0	1	0	0	1
4 mins 15 secs	9	1	1	0	1	1	1	1	1	1	1
2 mins 33 secs	6	0	1	0	1	0	1	1	1	1	0
4 mins 52 secs	8	1	1	0	1	1	1	1	0	1	1
2 mins 2 secs	6	0	1	0	1	1	0	1	1	1	0
3 mins 47 secs	7	0	1	0	1	1	1	0	1	1	1
5 mins 1 sec	4	1	1	0	1	0	0	0	1	0 -	
3 mins 32 secs	7	0	1	0	1	1	0	1	1	1	1
3 mins 32 secs	6	0	1	0	1	1	1	0	0	1	1
	7	1	1	0	1	1	1	1	1	1	1

World Regional Geography Pre-Test

1. Name the Seven Continents

a. North America
b. South America
c. Australia
d. Europe
e. Africa
f. Asia
g. Antarctica

2. What are the two largest religions in the world?

Christianity and Islam

3. Which country is largest in land size?

Russia

4. Which country has the largest population?

China ~~or India~~

5. Which country is also a continent?

Australia

6. Which country has the most powerful economy (highest GDP)?

United States

7. What is the world's largest lake?

Lake Victoria

8. What kind of climate does the country of Vietnam have?

9. What is a third world country?

A country that has a certain % of people below the poverty line.

10. Who was Siddhartha Gautama?

11. Where does the Pope reside?

Rome

12. What is the longest river in the world?

Nile

13. Which country has the smallest population?

Starts with an L

14. What is the southern tip of South America called?

horn of South America ?

15. What is the largest country by land size in Africa?

West Africa

Walking For Fitness

Beginning of Semester Pre-test

1. Do you know what BMI is?
   If you do, please describe it.

Body Mass Index- How much fat you have on your body

2. What is the best time of day for walking?

   Morning

3. Name three things you should do to be safe when walking.

   Stretch, Watch for cars and kidnappers, warm-up

4. How do you find your target heart rate for walking?

   IDK

5. What is a 5K?
   3.2 miles

6. Name a public walking trail near you?

   UARM has one around the pond

7. Do you know how to operate a pedometer?
   I know how to operate the health app on my phone, but do not have a pedometer to figure it out.

uestion 1

Not answered

Marked out of 1

Edit question

What is the collection of unorganized facts?

Answer:

The correct answer is: Data

Make comment or override mark

Response history

Step	Time	Action	State	Marks
1	15/01/20, 15:24	Started	Not yet answered	
2	**15/01/20, 15:30**	**Attempt finished**	**Not answered**	

Question 2

Not answered

Marked out of 1

Edit question

The _____ are a framework for innovation in education.

The correct answer is: ISTE Standards

Make comment or override mark

Response history

Step	Time	Action	State	Marks
1	15/01/20, 15:24	Started	Not yet answered	
2	**15/01/20, 15:30**	**Attempt finished**	**Not answered**	

Question 3

Not answered

_____ describes a process in which 2 or more computers or devices transfer data, instruction, and information.

Step	Time	Action	State	Marks
3	15/01/20, 15:30	Attempt finished	Correct	1

Question 5

Not answered

Marked out of 1

Edit question

[ ] is the world's largest network of businesses, governments, educational institutions, and individuals.

The correct answer is: Internet

Make comment or override mark

Response history

Step	Time	Action	State	Marks
1	15/01/20, 15:24	Started	Not yet answered	
2	15/01/20, 15:30	Attempt finished	Not answered	

Question 6

Not answered

Marked out of 1

Edit question

A [ ] is a colleciton of data organized in a manner that allows access, retrieval, and use of the data.

The correct answer is: database

Make comment or override mark

Response history

Step	Time	Action	State	Marks
1	15/01/20, 15:24	Started	Not yet answered	
2	15/01/20, 15:30	Attempt finished	Not answered	

Edit question

The correct answer is: Application software

Make comment or override mark

Response history

Step	Time	Action	State	Marks
1	15/01/20, 15:24	Started	Not yet answered	
2	**15/01/20, 15:30**	**Attempt finished**	**Not answered**	

Question 10

Correct

Mark 1 out of 1

Edit question

Chrome is one of the three most popular Web browsers.

The correct answer is: Chrome

Make comment or override mark

Response history

Step	Time	Action	State	Marks
1	15/01/20, 15:24	Started	Not yet answered	
2	15/01/20, 15:30	Saved: Chrome	Answer saved	
3	**15/01/20, 15:30**	**Attempt finished**	**Correct**	**1**

Question 11

Correct

Mark 1 out of 1

Google is one of the three most popular search engines.

The correct answer is: Yahoo

Make comment or override mark

Response history

Step	Time	Action	State	Marks
1	15/01/20, 15:24	Started	Not yet answered	
2	**15/01/20, 15:30**	**Attempt finished**	**Not answered**	

Question 14

Not answered

Marked out of 1

Edit question

_____ is a scam in which a perpetrator sends an official-looking email that attempts to obtain personal and financial information.

The correct answer is: Phishing

Make comment or override mark

Response history

Step	Time	Action	State	Marks
1	15/01/20, 15:24	Started	Not yet answered	
2	**15/01/20, 15:30**	**Attempt finished**	**Not answered**	

Question 15

Not answered

Marked out of 1

Edit question

_____ is an unsolicited email message.

The correct answer is: Spam

Make comment or override mark

Spring 2020 _____ Name

Pre- and Post-Test for

Instructional Technology

1. _____ is the collection of unorganized facts.
2. The _____ are a framework for innovation in education.
   a. Learning how to repair a computer or device.
   b.
   c. Applying existing knowledge to generate new ideas, products, or processes.
3. _____ describes a process in which 2 or more computers or devices transfer data, instruction, and information.
4. _____ created the World Wide Web so computers could share information.
   a. Bill Gates
   b. Steve Jobs
   c. Steve Wozniak
   d. Tim Berners Lee
5. _____ is the world's largest network of businesses, governments, educational institutions, and individuals.
6. A _____ is a collection of data organized in a manner that allows access, retrieval, and use of data.
7. The _____ consists of many electronic components in the system unit that reside on a circuit board.
8. _____ is the place to find the Arkansas competencies for Secondary Teachers: Computer Science, Grades 4-12.
9. _____ consists of programs designed to perform specific tasks for users.
10. _____ is one of the three most popular of Web browsers.
11. _____ is one of the three most popular search engines.
12. _____ was passed to protect children from obscene, pornographic, and other information that is considered harmful.
13. _____ means the original author or creator of the work retains ownership for the work and has exclusive right to reproduce and distribute the created work.
14. _____is a scam in which a perpetrator sends an official-looking email that attempts to obtain personal and financial information.
15. _____ is an unsolicited email message.

Spring 2020 _____ Name

A&P II pre/post test

Name_____

MULTIPLE CHOICE. Choose the one alternative that best completes the statement or answers the question.

1) All hormones are 1) D
A) proteins. B) steroids.
C) inorganic compounds. D) organic compounds.

2) A sweat gland is an example of a(n) _____ gland. 2) B
A) endocrine B) exocrine C) paracrine D) autocrine

3) Nerve fibers in the posterior lobe of the pituitary gland secrete 3) B
A) thyroid-stimulating hormone. B) adrenocorticotropic hormone.
C) antidiuretic hormone. D) growth hormone.

4) Cyanosis is caused by an increased blood concentration of 4) A
A) carbon dioxide. B) carbon monoxide.
C) deoxyhemoglobin. D) oxyhemoglobin.

5) The proteins that B cells produce that attack foreign molecules are 5) A
A) antibodies. B) MHC complexes.
C) lymphocytes. D) interleukins.

6) Thrombocytopenia is due to a deficiency of 6) C
A) vitamin K. B) leukocytes. C) platelets. D) factor VII.

7) When smooth muscles in the walls of the arteries are stimulated to contract, 7) B
A) peripheral resistance decreases. B) blood pressure increases.
C) viscosity increases. D) blood pressure decreases.

8) Which of the following is the correct sequence of parts through which blood moves from the vena cava to the lungs? 8) D
A) Right ventricle, pulmonary valve, right atrium, tricuspid valve, right ventricle
B) Right atrium, pulmonary valve, right ventricle, tricuspid valve
C) Right ventricle, tricuspid valve, right atrium, pulmonary valve
D) Right atrium, tricuspid valve, right ventricle, pulmonary valve

9) The normal pacemaker of the heart is the 9) A
A) atrioventricular node. B) sinoatrial node.
C) Purkinje fibers. D) AV bundle.

10) The longest vein in the body is the 10) _____

A) internal iliac vein.
B) great saphenous vein.
C) superior vena cava.
D) hepatic portal vein.

11) An immune response that is slower but more specific for the pathogen is the 11) A

A) adaptive defense.
B) inborn defense.
C) innate defense.
D) nonspecific defense.

12) Cells in a lymph node that engulf and destroy damaged cells, foreign substances, and cellular debris are 12) D

A) lymphocytes.
B) cytokines.
C) mast cells.
D) macrophages.

13) The tissues turning yellow (jaundice) is due to the accumulation of 13) A

A) carotene.
B) hemoglobin A.
C) bile pigments.
D) cholesterol.

14) One of the functions of the large intestine is to 14) D

A) break down hemoglobin.
B) regulate the release of bile.
C) secrete digestive enzymes.
D) absorb ingested water.

15) Peristalsis occurs in the digestive tract 15) B

A) from the pharynx to the anus.
B) in the stomach, small intestine, and large intestine.
C) in the stomach and small intestine only.
D) in the small and large intestines only.

16) Carbohydrates, proteins, and fats are 16) C

A) micronutrients.
B) piconutrients.
C) macronutrients.
D) nanonutrients.

17) BMI measures 17) B

A) the amount of body fat.
B) weight in proportion to height.
C) volume in proportion to area.
D) the basal metabolic rate.

18) Cells of the _____ system require a continuous supply of glucose. 18) B

A) digestive
B) nervous
C) respiratory
D) muscular

19) The force that moves air into the lungs during inspiration comes from the 19) C

A) abdominal wall muscles.
B) atmospheric pressure.
C) diaphragm.
D) external intercostal muscles.

20) Atelectasis is 20) C

A) a deviated septum.
B) a collapsed bronchial tube.
C) a collapsed lung.
D) a shrunken liver.

21) Which of the following is important in maintaining the pH of blood? 21) B

A) Nitrogen
B) Carbon dioxide
C) Oxygen
D) Phosphate

22) Females are at higher risk of contracting a urinary tract infection because 22) B

A) the female urethra is longer than the male's.
B) the female urethra is shorter than the male's.
C) women sit down to urinate.
D) women use toilet paper when they urinate.

23) The respiratory center is most likely to increase the breathing rate if the 23) A

A) pH of body fluids is decreasing.
B) concentration of carbonic acid is decreasing.
C) pH of body fluids is increasing.
D) concentration of sodium bicarbonate is increasing.

24) Hyperventilation leads to 24) C

A) metabolic alkalosis.
B) respiratory acidosis.
C) respiratory alkalosis.
D) metabolic acidosis.

25) A Pap smear is used to detect abnormal cells in the 25) B

A) ovary.
B) cervix.
C) vagina.
D) urethra.

26) Meiosis is necessary because 26) B

A) otherwise too many mutations will occur.
B) otherwise the fertilized ovum will have too much genetic material.
C) otherwise reproduction would have to be asexual.
D) otherwise the fertilized ovum will have too little genetic material.

27) An allele that is not expressed in the heterozygous condition is 27) C

A) dominant.
B) codominant.
C) recessive.
D) autosomal.

28) An offspring of parents whose genotypes are Aa and Aa may be 28) A

A) AA, Aa, or aa.
B) only Aa.
C) AA or aa.
D) only aa.

DT

CST283 – Database Applications

Date: 1-13-2020

1. How can you identify a linked table in a database?
   a. A linked table appears with a link icon in the Navigation Pane.
   b. A linked table opens in a separate window, not on a tab.
   c. A linked table is red in the Linked Table Manager.
   d. A linked table has "Linked" at the beginning of its name.

2. You can copy and paste any object in Access except for tables.
   a. True
   b. False

3. To share form data among two or more programs, export the form as a(n) _____ file.
   a. another Access database
   b. Excel
   c. XML
   d. PDF

4. The _____ property creates an easy-to-use visual guide to help users enter accurate data.
   a. Phone Number
   b. Pattern
   c. Input Mask
   d. Default Value

5. What criterion should you use in the Bedrooms field to select records of houses for sale with exactly four bedrooms?
   a. 4
   b. >=4
   c. <>4
   d. "Is 4"

6. You use _____ to mark up structured data so you can easily share the data with other programs.
   a. XML
   b. HTML
   c. ODBC
   d. dBase

A. Cheating on an examination or the preparation of academic work. Any student who engages in any of the following shall be deemed to have engaged in cheating.

- Copying from another student's test paper, laboratory report, other report, computer file, data, listings and/or programs;
- Using during a test, materials not authorized by the instructor;
- Collaborating with another person without authorization during an examination or in preparing academic work;
- Knowingly and without authorization, using, buying, selling, stealing, transporting, soliciting, copying or possessing in whole or in part, the contents of an un-administered examination;
- Substituting for another student, or permitting another student to substitute for oneself in taking an examination or preparing academic work;
- Bribing another person to obtain an un-administered examination or information about an un-administered examination;
- Attempting to bribe any faculty/staff or student to alter a grade.

B. Plagiarizing or appropriating another work or idea without properly acknowledging the incorporation of that work or idea into one's own work offered for credit.

C. Any forgery, alteration or misuse of academic documents, forms or records.

D. Fabrication includes the intentional falsification or invention of any information.

E. Collusion includes any secret agreement among students who participate in any academically dishonest activity.

F. Students in online courses agree not to give their passwords, login information, or access to an online course to anyone. Any student who does so will be considered guilty of academic dishonesty and subject to the penalties described for such offenses.

Penalties for Academic Misconduct: Academic misconduct will result in a minimum of a zero grade for the paper, assignment or test on which the violation occurred. Repeated occurrences will incur more severe action, with the possibility of a zero for the course. Instructors may choose a more stringent course of action.

Disability Policy: It is the policy of UA Rich Mountain to accommodate students with disabilities, pursuant to state and federal law. Any student with a disability who needs accommodations should contact the Associate Vice President for Student Affairs Office, 394-7622 ext.1460.

Arkansas Clean Air Act: In compliance with the Arkansas Clean Air Act, UA Rich Mountain is a smoke and tobacco free facility. Students and guests are to refrain from the use of all tobacco products while on campus.

Student Misconduct: Students committing misconduct are subject to disciplinary sanction(s) and or restrictions. Misconduct or prohibited behavior includes, but is not limited to endangerment, harassment, disruption, sexual misconduct, dishonesty, illegal drugs and/or alcohol, fire or safety issues, gambling, property violations, computer violations or other violations as listed in detail in the UA Rich Mountain catalog.

Cell phone policy: The use of cell phones, smart phones, or other mobile communication devices is disruptive, and is therefore prohibited during class. Except in emergencies, those using such devices must leave the classroom for the remainder of the class period.

UA Rich Mountain Mission: UA Rich Mountain exists to provide all residents of the Ouachita Mountain Region with exemplary educational and enrichment opportunities to improve the quality of life and standard of living.

*****All syllabus content subject to change at instructor's discretion*****

CST283

Database Applications

Spring 2020 Classroom

Class Time and Location: M/W 11:00 – 12:15
Instructor Name: Debbie Todd
Office Location: Maddox 152
Office Hours: By Appointment
Office Phone: 479.394.7622 ext. 1245

Prerequisite: CST113 Intro to Computers or permission of instructor

Required Materials

1. **Textbook**: Pratt, Last. Microsoft Access 2016 Comprehensive. Course Technology, 2017. ISBN 978-1-305-88147-1.

2. **Flash/Jump Drive:** Students should purchase a USB Flash/Jump Drive to store their computer work. It is recommended to keep a backup of all of your work.

3. **E-mail address**: Students are required to activate their UA Rich Mountain student email address and check it regularly.

4. **Microsoft Access 2016**: Students must have access to this software in order to complete course assignments. The software is available on all UA-Rich Mountain student computers. A free download of Microsoft Office 365 is available to students while they are enrolled at UA-Rich Mountain. In order to receive the information for this download, go to the following link and fill out your information. http://www.uarichmountain.edu/departments-and-staff/computer-services/365-request Once completed, the IT department will submit your information to Microsoft. Microsoft will send an email with instructions on how to download the software to your student email account.

Resources and References

- **Student Support Services** (located in the Johnson Learning Commons) provides aid and tutoring to students. Even if you don't need assistance you may work with the Access 2016 software in this computer lab.
- **Johnson Learning Commons-**The JLC has a computer lab available to students. Hours will be posted on the door and the UA Rich Mountain website.
- **Learning Enrichment and Advising** Center (LEAC) provides aid and tutoring to students.
- **Microsoft Office Tools on the Web** – http://office.microsoft.com. A world of information on Microsoft Office, including Access 2016.

Course Description: This course will cover the principles and practical applications of database management software for computers. The student will gain knowledge and proficiency in the use of database software through class lecture and lab exercises with various database problems.

- **Homework** will consist of work done both in and outside the classroom. Specific hand-in requirements, etc. will be given with each assignment. Tutorials must be completed and submitted with lab assignments. No lab assignments will be accepted for grading unless accompanied with the chapter tutorial.
- **Exams** will be given periodically throughout the semester and will normally cover multiple chapters. Exams may consist of written work, computer-based work, or a combination of both.
- **Quizzes** may be given at any time or not at all.

Grading Scale

A: 90 – 100%
B: 80 – 89%
C: 70 – 79%
D: 60 – 69%
F: 59% and below

Late Homework: All quizzes and exams must be completed and submitted by the due date and time, and will not be accepted late. Chapter lab assignments are also due on the assigned due date and time. However, students will be allowed to have two grace days during a semester. With the grace day, students will have a one school day grace period where no penalty will be given for late hand-in of an assignment. It is your responsibility to get the homework turned in to me during the grace day. After the two grace days are used, homework will be considered late, regardless of the reason. Homework will be penalized 15% per day late for up to three school days. Beyond two school days late homework will not be accepted. Grace days do not apply to exams and quizzes. Only one grace day can be used on any given assignment and grace days cannot be used on the final chapter assignments.

Exam Makeup: All missed exams must be taken within the next 2 week days from the original exam period. If a student wishes to makeup an exam they will be required to provide a reasonable explanation for missing the original exam date. Students may also be required to provide documentation for the absence. Any missed exams will be considered on a case by case basis. It is the student's responsibility to contact the instructor as soon as possible regarding a makeup exam. Students will only be allowed one make-up exam per semester.

Class Procedures/Student Requirements: Students are expected to attend every class and remain in class for the duration of the session. Failure to attend class or arriving late may impact your ability to achieve course objectives which could affect your course grade. An absence, excused or unexcused, does not relieve a student of any course requirement. Regular class attendance is a student's obligation, as is a responsibility for all the work of class meetings, including tests and written tasks. Excessive unexcused absences or tardiness (affecting more than or equal to 20% of class meetings) will result in a loss of a letter grade. See the "Course Requirements/Evaluation" section for details on late homework or makeup exams.

Classes will consist of lecture and lab time. Students are expected to be focused and pay attention, as well as ask questions during lecture and to be working on assignments for this class during lab time. A student working on other classwork, or surfing the web during lab time may be asked to leave.

Academic Dishonesty: Rich Mountain Community College expects students to adhere to a strict code of academic honesty. Students should learn in an environment of integrity, free from the intrusion of any kind of dishonest conduct. When an academic exercise is designed to result in a grade, any of the following activities constitute violations of academic honesty (unless expressly authorized in advance by the instructor) and will be subject to disciplinary action:

Danny Trailkill

NAME: [redacted]

52

TRUE OR FALSE (four points each)

Please circle the correct answer.

T F 1. All leases must be in writing.

T F 2. A contract made by a minor is a void contract.

T F 3. A bankruptcy action is filed in State Court.

T F 4. Distraint is the lessor's right to levy upon the lessee's personal property for non-payment.

T F 5. A Chapter 12 bankruptcy involves restructuring the debt of an agricultural business.

T F 6. Arkansas follows the "mirror image" rule.

T F 7. Under certain circumstances, one may be forced into involuntary bankruptcy.

T F 8. An acceptance is a promise that is communicated.

T F 9. A lease where rental increases are tied to the Consumer Price Index is an example of a net lease.

T F 10. The most common bankruptcy is a Chapter 11 liquidation.

T F 11. The forbearance of a legal right may constitute consideration.

T F 12. A bankruptcy remains on one's credit report for 10 years.

T F 13. Only businesses may reorganize under Chapter 13 of the Bankruptcy Code.

T F 14. Parties to contracts are presumed to be competent.

T F 15. Most debtors are eligible for a discharge in bankruptcy once every four years.

T F 16. An employer may monitor an employee's email at work.

T F 17. The duration of a lease is known as the "term".

T F 18. The remedy to compel one to convey a unique item is known as specific

PL

4/19

World Civilization I
Pre-test

This is a brief test of your basic knowledge of ancient world civilizations. Answer as many as you can, you will not be graded on this.

✓ 1. The fertile land between the Tigris and Euphrates rivers is known as Mesopotamia

2. In the early years, Babylon united all of Mesopotamia under a great King. This King is known for his Code of Laws. What was his name? _____

3. What is the great ancient empire in Africa located along the Nile that rivaled that of Egypt _____

✓ 4. Who was the man who led the Hebrew people out of enslavement in Egypt? Moses

5. The Hebrew people were originally divided into how many tribes? 10

6. In Hindu religion, what is moksha?

7. Who was the Indian Prince who will become enlightened and referred to as the Buddha?

8. Who was the Chinese philosopher that stressed education and relationships? _____

9. Chinese Emperor, Shihuangdi, will have soldiers built to protect his tomb. What are these soldiers called? _____

✓ 10. Which Greek city-state was known for its warrior like attitude and its total absence of any type of luxury? Spartan

11. Who was the Jew that converted to Christianity and was responsible for spreading this new religion throughout the Roman Empire? _____

12. Who will receive the message of the Koran (Quran) from Allah and found the religion of Islam? _____

Pre-test MTH 223-01 NS II 46%

Score 5.5/12

Nam[redacted]

Date 1/15/2020

+1 **1.** The length of a rectangular garden is 3 feet less than 5 times the width. If *w* is the width, write the expression for the length in terms of *w*. 5w − 3

+1 **2.** Determine the mode for the following set of numbers. 24, 32, 44, 32, 16, 24, 50, 24
Write the mode and explain why that is your answer. 24

It's the number that is most frequent number.

3. A technology company founder buys an estate in California for three times the previously highest recorded sale price of any property. Which statewide housing market statistic will be most affected? Choose one and defend your answer.

Range Median Mode Mean

or else

It will change the average cost of the housing market.

4. Draw a box-and-whisker plot for the following test scores in an Algebra class. Include an asterisk (*) for the outlier.

Test scores: 99, 60, 97, 73, 95, 74, 81, 81, 82, 94, 92, 90, 86, 83, 84

It's been too long since I have done one of these.

+1 **5.** What is the difference between a pie chart and an exploding pie chart? Write your answer or draw and label to explain.

pie chart (info inside)

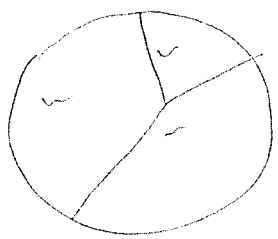

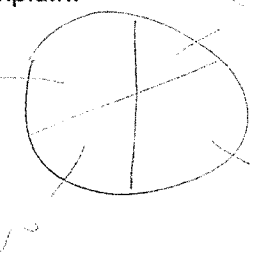

exploding pie chart (info outside)

6. If you were to flip a coin three times, what would the probability be that you would flip tails two of the three times? Diagram and write your answer.

I dont know.

Pretest for English Composition II

Student Name: _____

.ircle the correct answer.

1. What is the term for a writer who brings to light concerns over power, politics, and agency to draw awareness to problems?
   a. Local Colorist
   b. Literary Critic
   c. Historical Analyst
   d. Social Critic
2. In "Desiree's Baby," Kate Chopin took a critical review of what issue?
   a. Slavery
   b. The Holocaust
   c. World War I
   d. Single parents
3. In "Terrible Things," anthropomorphism is used to tell what the story of what?
   a. The birth of America
   b. Slavery
   c. The Holocaust
   d. World War I
4. *All Systems Red* focuses on what?
   a. The history of technology
   b. The humanity of a robot
   c. The dangers of a segregated society
   d. The theme of control
5. *Murder on the Orient Express* emphasizes what?
   a. The racism that existed in the early-20th century
   b. The dangers of a female traveling alone by train in a foreign country
   c. The beginning of the technological era in the U.S.
   d. The repercussions of the tragic loss of a child
6. Which of the following is the correct punctuation for a quotation within a quotation?
   a. "The woman bowed her turbaned head majestically, "Mais si, Madame.""
   b. "The woman bowed her turbaned head majestically, 'Mais si, Madame.'"
   c. 'The woman bowed her turbaned head majestically, "Mais si, Madame."'
   d. "The woman bowed her turbaned head majestically, 'Mais si, Madame.'"
7. Which of the following uses the correct verb for a literary analysis essay?
   a. Roth portrays Beatrice as a weak character before developing her into the strong female character as Tris.
   b. Roth portrayed Beatrice as a weak character before developing her into a strong female character as Tris.
   c. Beatrice is portrayed as a weak character and then developed into a strong female character as Tris.
   d. The portrayal of Beatrice as a weak character before developing her into the strong female character as Tris.
8. Which of the following statements is the BEST written for a literary analysis paper?
   a. I think Mathilde is very vain.
   b. Mathilde might be vain.
   c. Mathilde is vain.
   d. I believe Mathilde is vain.

2/10

Skip to main content

General Psychology Sec IN18-Francis

Started on	Sunday, 12 January 2020, 10:40 AM
State	Finished
Completed on	Sunday, 12 January 2020, 10:48 AM
Time taken	7 mins 53 secs
Grade	**2.00** out of 20.00 (**10%**)
Feedback	Oh well. This is why you are taking the class.

Question 1

Incorrect

Mark 0.00 out of 1.00

Edit question

Question text

If I run a mile every morning because I want to lose weight before my class reunion, I am _____ motivated.

Select one:

a. Extrinsically

b. Intrinsically

c. Primarily

d. Secondarily

Question 2

Incorrect

Mark 0.00 out of 1.00

Edit question

Question text

The short fibers that branch out from the cell body and pick up incoming messages.

Mark 0.00 out of 1.00

Edit question

Question text

Psychology grew out of two existing sciences: _____ and _____.

Select one:

a. philosophy & physiology

b. biology & pathology

c. anthropology & physiology

d. chemistry & biology

Question 6

Incorrect

Mark 0.00 out of 1.00

Edit question

Question text

When I eat because I am hungry, I am attempting to maintain **homeostasis.**

Select one:

True

False

Response history

Question 7

Correct

Mark 1.00 out of 1.00

Edit question

Question text

A sample in which everyone in a population has an equal chance of being selected to the sample is known as a ____ sample.

Select one:

Question 10

Incorrect

Mark 0.00 out of 1.00

Edit question

Question text

The idea that a behavior will increase or decrease based on the consequences that follow that behavior is crucial to _____.

Select one:

a. operant conditioning

b. vicarious learning

c. classical conditioning

d. insight learning

Question 11

Incorrect

Mark 0.00 out of 1.00

Edit question

Question text

Most middle-aged adults can vividly recall where they were and what they were doing the day the John F. Kennedy was assassinated, although they cannot remember what they were doing the day before he was assassinated. This is an example of _____.

Select one:

a. a flashbulb memory

b. a procedural memory

c. a semantic memory

d. an eidetic image

Question 12

Incorrect

Mark 0.00 out of 1.00

Mark 0.00 out of 1.00

Edit question

Question text

A social researcher is studying a group of Kindergarten children; she is interested in seeing how they interact with children of the same sex and with those of the opposite sex. She secures permission to go to the children's school and observe them at recess. What type of research method is she using?

Select one:

a. Case Study

b. Survey

c. Naturalistic

d. Cross-Sectional

Question 15

Incorrect

Mark 0.00 out of 1.00

Edit question

Question text

Lawrence Kohlberg is noted for his theories of **social** development.

Select one:

True

False

Question 16

Incorrect

Mark 0.00 out of 1.00

Edit question

Question text

Select one:

a. cyclothymia

b. dysthymia

c. minor depressive episode

d. major depressive episode

Question 19

Incorrect

Mark 0.00 out of 1.00

Edit question

Question text

According to Freud, a girl's sexual attachment to her father and jealousy of her mother is called _____.

Select one:

a. the Electra complex

b. the Oedipus complex

c. transference

d. countertransference

Question 20

Correct

Mark 1.00 out of 1.00

Edit question

Question text

An individual's unique pattern of thoughts, feelings, and behaviors that persists over time and across situations _____.

Select one:

a. learning

Halli Holland

Jerod McCormick

Started on	Wednesday, 15 January 2020, 1:50 PM
State	Finished
Completed on	Wednesday, 15 January 2020, 1:52 PM
Time taken	2 mins 29 secs
Grade	**2.50** out of 5.00 (**50%**)

Question 1

Partially correct

Mark 2.50 out of 5.00

Edit question

In a matching format, please tell me what you know about our 6 nutrients.

Vitamins	Micronutrient ✓
4 kcal/g	Water ✗
Macronutrient	Water ✗
9 kcal/g	Carbohydrates ✗
Minerals	Water ✗
Water	Carbohydrates ✗
Macronutrient	Carbohydrates ✗
4 kcal/g	Carbohydrates ✗
Macronutrient	Protein ✗
Most important nutrient	Water ✓

Your answer is partially correct.

You have correctly selected 2.

The correct answer is: Vitamins – Micronutrient, 4 kcal/g – Carbohydrates, Macronutrient – Protein, 9 kcal/g – Lipids, Minerals – Micronutrient, Water – Micronutrient, Macronutrient – Lipids, 4 kcal/g – Protein, Macronutrient – Carbohyrdates, Most important nutrient – Water

Comment:

Make comment or override mark

Response History

Story
49
100

Cats English
Period
Spring 2020

The Great Grammar Book

Diagnostic Test

Circle the correct word choice.

1. A necklace made from the claws of a grizzly bear and a Colt .45 six-shooter once owned by "Buffalo Bill" Cody **was/were** sold at an auction in Dallas for more than $40,000 each.

2. A high fat diet, obesity, and lack of exercise **increases/increase** the risk of developing heart disease and Type 2 diabetes, even in young people.

3. **Here's/Here are** news articles about computers being given to a Brazilian jungle tribe.

4. The profit margins at a typical warehouse club **is/are** between 11% and 14%, compared with 25% to 30% at a typical grocery store.

5. A wound infested with maggots **heals/heal** quickly without any threat of infection or gangrene.

6. American consumers have learned that the days of unlimited low cost energy **is/are** over.

7. **There's/There are** 251 school days in China a year, which is 71 more days than in American schools.

8. *Battlefield 3* or *Crysis 2* **has/have** the most realistic game graphics.

9. The pattern of stars that looks like twin boys **is/are** called Gemini, or the Twins.

10. Did you know that **its/it's** the moon that causes the tide to rise and fall?

11. In Texas **its/it's** illegal to shoot a buffalo from the second story of a hotel.

12. For nearly 100 years the Coca Cola Company has been using legal means to protect **its/it's** trademark name.

13. In 1958 a nuclear bomb was lost somewhere along the swampy coast of Georgia and **its/it's** whereabouts remain a mystery to this day.

14. On the island of Santorini, Greece, donkeys are often used in place of taxis for transporting tourists and **their/there** luggage.

15. Teddy Roosevelt, **who's/whose** life was dramatically altered by the tragic deaths of his mother and wife on the same day, went on to become the 26th president of the United States.

~~34.~~ By the time a child is six, **he or she/they** can recognize almost 200 company logos.

~~35.~~ Convincing **us/we** students that we need more testing is a difficult task.

~~36.~~ Brandon told Annie and **I/me** that his father is serving on board the USS Sterett, a $1.3 billion missile destroyer.

~~37.~~ Since the Bennets buy gourmet cereals, are always in Starbucks, and constantly wear designer clothes, they spend a lot more money than **we/us**.

38. From the Internet's humble beginnings in the 1980s, usage has **rose/risen** dramatically.

39. The ozone layer is a layer of the upper atmosphere that **lies/lays** about 12-15 miles above the earth's surface.

40. Recent research on vitamin D has **showed/shown** that taking this vitamin can cut cancer rates and reduce the risk of heart attacks.

41. This thermos has **sprang/sprung** a leak.

15 42. Lucy **come/came** in third in the last race.

In the following "sentences" write 'F' beside each sentence fragment (incomplete sentence), write 'R' beside each run-on sentence, and write 'C' beside each of the sentences that is already correct.

R S ~~43.~~ First we laughed, then we cried.

C F ~~44.~~ Please speak softly.

F S ~~45.~~ As long as you remember how to get there.

C R ~~46.~~ A study at the University of Toronto found that individuals who identified themselves as conservatives were higher in the personality trait of orderliness, while those who self-identified as liberals were higher in empathy.

F 47. If you really want to be a better employee.

R S ~~48.~~ The left side of your brain controls the right side of your body, the right side of your brain controls the left side of your body.

C S ~~49.~~ The first son of a U.S. president to also become a president was John Quincy Adams, whose father was John Adams.

C F ~~50.~~ Hurry!

In the following sentences add capital letters and underlining (to indicate italics) where they are needed. (One sentence is already correct.)

67. John Steinbeck's novel the grapes of wrath tells how poor oklahoma farmers traveled to california during the great depression of the 1930s.

68. The restoration is an english historical period during which the monarchy was restored, following a period known as the commonwealth, when england had no king or queen.

69. Weather forecasters are predicting heavy spring rains which will help fill our reservoirs to meet the heavy demand of summer and fall.

70. Bryan Cranston, portraying President Lyndon Johnson, won the 2014 Tony Award for best actor in the Broadway play All the Way.

71. Hundreds of native american reservations and pueblos are open to the public including taos pueblo in new mexico, pine ridge reservation in south Dakota, and hopi villages in arizona.

72. The six official languages of the united nations are english, french, arabic, chinese, russian, and spanish.

73. Blake said that the band destiny's child was a loser on star search.

74. Angel falls, which plunges 3,212 feet into the churun river in eastern venezuela, has a longer drop than any other waterfall in the world.

75. As a young, struggling dancer in new york city, madonna worked as a counter clerk at dunkin' donuts in times square.

76. Jay gatsby, the main character in f. scott fitzgerald's novel the great gatsby, hopelessly attempts to revive an old romance.

In each of the following sentences, correct the one grammatical mistake by crossing out the error and making the correction above it.

77. I'm not going in that cave because it's ~~to~~ too spooky in there.

78. President James Monroe's daughter was the first member of a presidents family to be married in the White House.

79. You never realize how boring ~~you're~~ your life is until someone asks you what you do for fun.

80. In Tokyo riding a bicycle for short trips is ~~alot~~ a lot faster than taking a car.

81. Please give me ~~there~~ your e-mail address as soon as possible.

82. I should have ~~knew~~ known that it was Isaac Newton, the English physicist, who discovered the law of gravity.

TVH

Product Name:Hawkes Learning Developmental Mathematics 2nd Edition
School Name:Rich Mountain Community College
Report Name: WebTest Summary by Test
Instructor: Trista Vanaelstyn- Hicks
Section: MATH 01
Test: Basic Math Pre-Test Spring 2020 (Trista Vanaelstyn- Hicks)
Date: 01/16/2020

Questions: 32 | Max Points: 64

Basic Math Pre-Test Spring 2020 (Trista Vanaelstyn- Hicks)				Questions					Time Information	
#	Student Name	Attempts	Score	Attempted	Correct	Incorrect	Not Answered	Unsimplified	Test Start	Elapsed (min)
1	HALE, KATHERINE	1	15.63%	16	5	11	16	0	01/13/2020	23
Total Marks			15.63%	16	5	11	16	0		23
Minimum			15.63%	16	5	11	16	0		23
Maximum			15.63%	16	5	11	16	0		23
Average			15.63%	16	5	11	16	0		23
Standard Deviation			0%	0	0	0	0	0		0
Median			15.63%	16	5	11	16	0		23
First Quartile			N/A	N/A	N/A	N/A	N/A	N/A		N/A
Third Quartile			N/A	N/A	N/A	N/A	N/A	N/A		N/A

Product Name:Hawkes Learning Developmental Mathematics 2nd Edition
School Name:Rich Mountain Community College
Report Name: WebTest Summary by Test
Instructor: Trista Vanaelstyn- Hicks
Section: MATH 02
Test: Beginning Algebra Pre-Test Spring 2020 (Trista Vanaelstyn- Hicks)
Date: 01/16/2020

Questions: 34 | Max Points: 68

Beginning Algebra Pre-Test Spring 2020 (Trista Vanaelstyn-Hicks)				Questions					Time Information	
#	Student Name	Attempts	Score	Attempted	Correct	Incorrect	Not Answered	Unsimplified	Test Start	Elapsed (min)
1	CRAWFORD, ANDERS.CRAWFORD@GMAIL.COM	1	32.35%	16	11	5	18	0	01/13/2020	37
2	DURBIN, ANGELA	1	23.53%	29	8	21	5	0	01/14/2020	89
3	GODWIN, SHELBY	1	2.94%	4	1	3	30	0	01/13/2020	24
4	GRAVES, CRYSTAL	1	17.65%	22	6	16	12	0	01/14/2020	46
5	MCCLOUD, BRITTANY	1	35.29%	33	12	21	1	0	01/13/2020	38
6	NOAH, AVORY	1	44.12%	21	15	6	13	0	01/13/2020	26
7	SAUNSTAIRE, WHYNE	1	20.59%	34	7	27	0	0	01/14/2020	47
Total Marks			25.21%	159	60	99	79	0		307
Minimum			2.94%	4	1	3	0	0		24
Maximum			44.12%	34	15	27	30	0		89
Average			25.21%	22.71	8.57	14.14	11.29	0		43.86
Standard Deviation			12.46%	9.79	4.24	8.76	9.79	0		20.17
Median			23.53%	22	8	16	12	0		38
First Quartile			17.65%	16	6	5	1	0		26
Third Quartile			35.29%	33	12	21	18	0		47

Product Name:Hawkes Learning Developmental Mathematics 2nd Edition
School Name:Rich Mountain Community College
Report Name: WebTest Summary by Test
Instructor: Trista Vanaelstyn- Hicks
Section: MATH 03
Test: Intermediate Algebra Pre-Test Spring 2020 (Trista Vanaelstyn- Hicks)
Date: 01/16/2020

Questions: 27 | Max Points: 54

Intermediate Algebra Pre-Test Spring 2020 (Trista Vanaelstyn- Hicks)				Questions					Time Information	
#	Student Name	Attempts	Score	Attempted	Correct	Incorrect	Not Answered	Unsimplified	Test Start	Elapsed (min)
1	BILL, ELIZABETH	1	3.70%	27	1	26	0	0	01/13/2020	38
2	BURTON, AMY	1	7.41%	27	2	25	0	0	01/14/2020	26
3	COON, TYLER	1	25.93%	17	7	10	10	0	01/14/2020	22
4	DEL CARMEN, JOHN BLEEZER	1	3.70%	25	1	24	2	0	01/13/2020	27
5	HANKINS, BRITTANY	1	11.11%	16	3	13	11	0	01/13/2020	30
6	KIMP, TASHA	1	0.00%	2	0	2	25	0	01/14/2020	35
7	KNIGHT, DANIELLE	1	11.11%	11	3	8	16	0	01/13/2020	50
8	LEE, MICHAEL	1	59.26%	27	16	11	0	0	01/13/2020	53
9	MCALLISTER, MACKENZIE	1	11.11%	27	3	24	0	0	01/13/2020	58
10	RICE, KAYLA	1	0.00%	21	0	21	6	0	01/14/2020	55
11	ROSS, AUBRIE	1	40.74%	22	11	11	5	0	01/14/2020	29
12	STINE, DESTINY	1	0.00%	27	0	27	0	0	01/13/2020	29
13	STRIEGLE, BREANNA	1	7.41%	27	2	25	0	0	01/13/2020	50
14	TRULOCK, KRISTEN	1	0.00%	15	0	15	12	0	01/14/2020	60
15	TSHUMA, NTANDOYENKOSI	1	77.78%	24	21	3	3	0	01/14/2020	59
16	VAUGHN, RHANDA	1	51.85%	25	14	11	2	0	01/14/2020	51
17	WISEMAN, TAYLOR	1	0.00%	27	0	27	0	0	01/14/2020	24
Total Marks			18.30%	367	84	283	92	0		696
Minimum			0.00%	2	0	2	0	0		22
Maximum			77.78%	27	21	27	25	0		60
Average			18.30%	21.59	4.94	16.65	5.41	0		40.94
Standard Deviation			23.51%	6.97	6.35	8.40	6.97	0		13.51
Median			7.41%	25	2	15	2	0		38
First Quartile			0.00%	16.5	0	10.5	0	0		28
Third Quartile			33.33%	27	9	25	10.5	0		54

JA

Pretest for English Composition II

Student Name: _____

ircle the correct answer.

1. What is the term for a writer who brings to light concerns over power, politics, and agency to draw awareness to problems?
   a. Local Colorist
   b. Literary Critic
   c. Historical Analyst
   d. Social Critic
2. In "Desiree's Baby," Kate Chopin took a critical review of what issue?
   a. Slavery
   b. The Holocaust
   c. World War I
   d. Single parents
3. In "Terrible Things," anthropomorphism is used to tell what the story of what?
   a. The birth of America
   b. Slavery
   c. The Holocaust
   d. World War I

2/10

4. *All Systems Red* focuses on what?
   a. The history of technology
   b. The humanity of a robot
   c. The dangers of a segregated society
   d. The theme of control
5. *Murder on the Orient Express* emphasizes what?
   a. The racism that existed in the early-20th century
   b. The dangers of a female traveling alone by train in a foreign country
   c. The beginning of the technological era in the U.S.
   d. The repercussions of the tragic loss of a child
6. Which of the following is the correct punctuation for a quotation within a quotation?
   a. "The woman bowed her turbaned head majestically, "Mais si, Madame.""
   b. "The woman bowed her turbaned head majestically, 'Mais si, Madame.'"
   c. 'The woman bowed her turbaned head majestically, "Mais si, Madame."'
   d. "The woman bowed her turbaned head majestically, 'Mais si, Madame.'"
7. Which of the following uses the correct verb for a literary analysis essay?
   a. Roth portrays Beatrice as a weak character before developing her into the strong female character as Tris.
   b. Roth portrayed Beatrice as a weak character before developing her into a strong female character as Tris.
   c. Beatrice is portrayed as a weak character and then developed into a strong female character as Tris.
   d. The portrayal of Beatrice as a weak character before developing her into the strong female character as Tris.
8. Which of the following statements is the BEST written for a literary analysis paper?
   a. I think Mathilde is very vain.
   b. Mathilde might be vain.
   c. Mathilde is vain.
   d. I believe Mathilde is vain.

9. According to MLA 8, which of the following is the MOST preferred in-text citation for a printed book in an essay where multiple books are cited?
   a. In the story, Richard Bach writes, "For most gulls, it is not flying that matters, but eating" (Bach 4).
   b. Johnathan Livingston Seagull says, "For most gulls, it is not flying that matters, but eating" (4).
   c. "For most gulls, it is not flying that matters, but eating," writes Richard Bach (Bach 4).
   d. In the story, Richard Bach writes, "For most gulls, it is not flying that matters, but eating" (4).
10. As a general rule of thumb, when a quotation is longer than _____ lines, the quote should use formatting for a block quotation.
   a. Three
   b. Four
   c. Five
   d. Six

PT

Date: 1-13-2020

1. How can you identify a linked table in a database?
   a. A linked table appears with a link icon in the Navigation Pane.
   b. A linked table opens in a separate window, not on a tab.
   c. A linked table is red in the Linked Table Manager.
   d. A linked table has "Linked" at the beginning of its name.

2. You can copy and paste any object in Access except for tables.
   a. True
   b. False

3. To share form data among two or more programs, export the form as a(n) _____ file.
   a. another Access database
   b. Excel
   c. XML
   d. PDF

4. The _____ property creates an easy-to-use visual guide to help users enter accurate data.
   a. Phone Number
   b. Pattern
   c. Input Mask
   d. Default Value

5. What criterion should you use in the Bedrooms field to select records of houses for sale with exactly four bedrooms?
   a. 4
   b. >=4
   c. <>4
   d. "Is 4"

6. You use _____ to mark up structured data so you can easily share the data with other programs.
   a. XML
   b. HTML
   c. ODBC
   d. dBase

KP

0/5

Name: [redacted]

CST124 Pretest / Posttest

1. In the following code, System.out.println(num) is an example of _____

   a. A complex method
   b. A value-returning method
   c. A local variable
   d. A void method

2. When an argument is passed to a method

   a. The method must not assign another value to the parameter that receives the argument
   b. Its value is copied into the method's parameter variable
   c. Its value may be changed within the called method
   d. Values may not be passed to methods

3. What is wrong with the following method call?

   displayValue (double x);

   a. displayValue will not accept a parameter
   b. Do not include the data type in the method call
   c. There is nothing wrong with the statement
   d. x should be a String

4. What is stored by a reference variable?

   a. An object
   b. A string
   c. A binary encoded decimal
   d. A memory address

5. This is a group of related classes:

   a. Archive
   b. Package
   c. Collection
   d. Attachment

Practice Questions

1. The amount of adult supervision that is needed depends on
   a. the number of children in the group.
   b. the activity.
   c. the developmental needs of children who are present.
   d. all of these.

D

2. The first-aid kit should be kept
   a. out of the reach of children.
   b. in an easily accessible location, clearly marked, and out of the reach of children.
   c. in a restroom.
   d. in a drawer, far from where children will play.

B

3. Frequent hand washing is important because
   a. children need to keep hands clean.
   b. it keeps germs from spreading.
   c. it is a positive social skill.
   d. it is a law.

B

4. An open-ended question
   a. has one right answer.
   b. has no right or wrong answer.
   c. has two answers.
   d. has a commonly repeated answer.

B

5. Children should be provided with these items for washing their hands:
   a. Cold water, bar soap, and paper towels
   b. Hot water, liquid soap, and a cloth towel
   c. Warm water, liquid soap, and paper towels
   d. Water and paper towels

C

23/30 96C

6. Children need their own space in the classroom for their coat and other belongings because
   a. it promotes their positive self-concept.
   b. it helps maintain good health.
   c. a and b.
   d. none of the above.

7. An example of a positive *nonverbal* communication is
   a. a smile.
   b. saying, "Good morning."
   c. ignoring a child's actions.
   d. moving away from a child.

8. At mealtime, a caregiver should
   a. insist that children finish all food on their plates.
   b. not offer any dessert until all their food is finished.
   c. only offer dessert to the children who remained quiet at the table while eating.
   d. none of the above.

9. When arranging a classroom, a teacher should
   a. keep the quiet and noisy activities together.
   b. put related activities near each other.
   c. provide a large, open area in the center of the room.
   d. arrange the furniture all along the walls.

10. The best example of an open-ended material would be
   a. an alphabet puzzle.
   b. playdough and cookie cutters.
   c. a coloring book and crayons.
   d. unit blocks.

11. The children have been asking for the same book to be read at story time every day for the past week. You will
   a. happily reread it, because you know children benefit from repetition.
   b. read a book that is similar to the one they enjoy.
   c. tell the children that they have heard that book too many times and will need to choose a new one.
   d. skip story time for a few days until they have forgotten about that book.

12. Children's play materials should be
   a. kept in closed containers.
   b. kept on low, open shelves.
   c. kept on shelves out of their reach.
   d. kept in a storage cabinet, to be taken out by the caregiver.

B

13. A developmentally appropriate group time
   a. lasts only a short time.
   b. gets the children actively involved.
   c. permits children to leave, if they wish.
   d. all of the above.

B

14. Why do you give children a warning before activities are about to change?
   a. It gives them time to clean up their toys.
   b. It provides them time to finish up an activity.
   c. It helps to quickly get their attention.
   d. It is a signal to come to the next activity right away.

B

15. You want children to learn the rules of conversation, so you
   a. give them practice talking, listening, and responding in casual conversation as you sit with them at the lunch table.
   b. let them know they cannot talk during lunch.
   c. tell them not to interrupt while you are talking.
   d. remind the children to use "inside voices."

A

16. A good early childhood practice is
   a. having the children line up to use the restroom.
   b. having the children sit outside the restroom to wait for their turn.
   c. having the children all do an art activity together.
   d. asking the children to pretend to be butterflies as they walk to the playground.

D

17. An activity that develops small-motor skills would be
   a. swinging.
   b. beanbag throwing.
   c. bead stringing.
   d. jumping.

C

18. An activity that develops small-motor skills would be

a. manipulating playdough.

b. walking on a balance beam.

c. throwing a ball.

d. riding a tricycle.

B

19. You have a small budget to use for purchasing materials for your classroom. When choosing, you will first consider

a. the price and how much you can buy with what you have.

b. the age range listed on the packaging.

c. whether the materials are developmentally appropriate, are mostly open-ended, and will enable the children to experience success.

d. whether the materials are familiar to the children from TV commercials.

C

20. Two boys want the same truck to haul blocks across the room. One boy goes to the housekeeping area and gets a basket. This is an example of

a. an open-ended question.

b. problem solving.

c. a small-motor exercise.

d. guidance.

B

21. When talking with a child, the caregiver should

a. speak loudly.

b. get down to the child's eye level.

c. whisper softly to the child.

d. stand and talk with the child.

B

22. Caregivers should

a. control the conversations that children have with them.

b. be good listeners.

c. ask a lot of open-ended questions.

d. b and c.

D

23. You want the children to learn cooperation, so you

a. insist that a child let everyone play with the toy he brought for show-and-tell.

b. discipline the children for not helping pick up the toys in the room.

c. play a song about cooperation.

d. provide activities that require taking turns, sharing materials, and solving problems together.

D

24. Children's artwork should be

a. put on bulletin boards in the hallways.

b. placed high on walls so other children cannot touch it.

c. displayed at the children's eye level.

d. put immediately into the children's cubbies to be taken home.

C

25. A creative arts project is

a. marble painting on turkey shapes.

b. painting at the easel on pumpkin-shaped paper with orange and black paint.

c. painting with orange and black paint on white paper.

d. sponge painting on a white ghost shape.

B

26. One of the children is having a tantrum just as circle time is beginning. The best way to proceed would be to

a. stay close to the child and explain to the others that she is having a hard time right now but will be all right in a few minutes. Let your co-teacher start the circle time.

b. call her parents to take her home.

c. take her to the director's office until she calms down.

d. have the child sit in the time-out chair until she can control her emotions and return to the group.

A

27. A creative activity is

a. cooking using a recipe.

b. stringing beads.

c. using playdough.

d. assembling a twenty-piece puzzle.

A

28. Which activity is creative?

a. Using a CD that tells children how to move

b. Dancing with scarves to an instrumental CD

c. Using musical instruments with a CD that tells children when to play them

d. Singing "Where is Thumbkin?"

29. A good technique for dealing with favorite toys is to

a. provide duplicates of them.

b. put them away when children squabble over them.

c. provide them as rewards for good behavior.

d. none of the above.

30. You are aware that many of the children watch a great deal of TV and videos at home. You would like the parents to support their children's development at home instead of relying on screen media. You will

a. confront the parents at drop-off time about the detrimental effects of too much screen time for young children.

b. send home a listing of suggested TV shows and children's videos.

c. send home book and activity packs that the children can enjoy with their families.

d. send home an educational video each Friday.

Oral Communications (Speech 203)

Fall 2020

ACTS: This course is listed in the Arkansas Course Transfer System (ACTS) with the following index number: **SPCH 1003**

Class Time and Location: Monday 6:00-8:45 WA 204

Instructor: Angela Tallmadge

Bachelor of Science, Elementary Education, December 1982

Master of Liberal Arts, Secondary English, May 1987

Educational Leadership, 14 hours, May 2010

Office Location: not applicable=adjunct **Classroom:** WA 204

Office Hours: 30 minutes before class begins or by arrangement

Telephone: (479)637-5502 **E-mail:** atallmadge@uarichmountain.edu
atallmadge@mansfieldtigers.org

Prerequisite: None

Resources:

- Sellnow, Deanna D., Verderber, Kathleen S. and Rudolph F.. *The Challenge of Effective Speaking, 15th Edition.* Boston, MA: Wadsworth, Cengage Learning, 2012. Print. ISBN-13: 978-0-495-91134-0
- Audio-Visual (A-V) aid material (It may be possible to use power point in class.)
- Speech outline required for every speech except for Introductory/Brown Bag Speech.
- Scantron: You will need a scantron and a #2 pencil (furnished by instructor) for midterm and final.

Course Description: This course will assist students through an integrated study of theory and practice to be more competent in oral communication situations. Emphasis will be placed on student preparation and presentation of various types of speeches. This course satisfies the requirement for teacher certification in Arkansas public schools. This course requires at least one paper using a documentation format.

Program Outcomes:

- Students will increase competencies in writing, reading, speaking, and listening.
- Students will increase their understanding of the human condition, as well as the culture and society of both the nation and the world in which they live.
- Students will apply technological and research skills to identify, locate, and process information.
- Students will be prepared to compete academically upon transfer to a four-year institution.

Rationale

The student will achieve the program outcomes by presenting five different speeches in class, creating speech outlines, hands-on speech activities as well as in class discussions.

Critical Thinking Skills

This class requires students to use their general knowledge and critical thinking skills. Students will be expected to analyze problems, arrive at intelligent conclusions, and make reasoned choices regarding the selection of speech topics, the use of facts and supporting materials, and the evaluation of what they and their fellow students say in class.

Topical Outline/Course Schedule

Week 1	Chapters 1
Week 2	Chapters 2
Week 3	Chapters 3 & 4
Week 4	Chapters 5
Week 5	Chapters 6 & 7
Week 6	Chapters continue 7
Week 7	Chapters 8 & 12
Week 8	Chapters continue 12
Week 9	Chapter 9 & 10
Week 10	Chapter continue 10
Week 11	Chapter 13
Week 12	Chapter continue 13 and 14
Week 13	Chapter 11

Introductory/Brown Bag Speech	January 20
Library Scavenger Hunt	February 10
Demonstration Speech	February 24
Midterm Exam	March 2
Informative Speech	March 16
Make-up speech date	April 6
Speech analysis	April 13
Persuasive Speech rough draft	April 20
Persuasive Speech (Final Speech)	April 27
Final exam covering material from text	May 4
Speech Outlines	Class meeting before speech cycle begins

Course Conduct

Lecture, discussion, student presentations, exercises, and tests will be included throughout the course.

U.A. Rich Mountain Credit Hour Calculator

For every course credit hour, students should expect to spend at least three clock hours per week of concentrated attention on course-related work, including but not limited to time attending class, as well as out-of-class time spent reading, reviewing, organizing notes, preparing for upcoming quizzes/exams, problem solving, developing and completing homework, and other activities that enhance learning. For a three hour course, a typical student should expect to spend at least nine hours per week dedicated to the course. This includes the time spent in class.

The introductory speech will be 2-3 minutes long. The speech to demonstrate, and the speech to inform will be 4-6 minutes in length, and 7-9 minutes in length for the persuasive speech.

An outline with sources listed using the template provided must

- state purpose of speech
- list main points in body
- typed
- bibliography of speech sources

The student will be graded by the following criteria:

Delivery	Use adequate and inclusive eye contact
	Use effective vocal tone, rate and volume, energy
	Articulate
	Varied inflection, good choice of words
	Appropriate facial expressions
	effective body language, posture, poise, gestures
	Purposeful movement
Topic	Original and interesting
	Appropriate for assignment and audience
	Substantive
	Narrowed sufficiently
Introduction	Captures attention (Attention Getter)
	Stated point of view
	Related topic to audience (Audience Relevance)
	Established Credibility (Speaker Credibility)
	Previewed main points in transition to body (Thesis)
Body	Organized main points effectively
	Included transition between main points
	Used language appropriate to topic and audience
	Used visual aids appropriately
	Showed mastery of the topic
Conclusion	Provided a transition into the conclusion
	Summarized main points
	Ended with a memorable final thought

The quality of fulfillment of the above criteria will be evaluated using the following subjective terms.

"A" = Brilliant, superior, excellent
"B"= Very good
"C"= Adequate, fair
"D"=weak, poor
"F"= didn't give presentation or read script

Grading Scale

90 – 100%	A
80 – 89%	B
70 – 79%	C
60 – 69%	D
59% or below	F

To reach a percentage, take the total number of points earned and divide by points possible

Arkansas Clean Air Act
In compliance with the Arkansas Clean Air Act, U.A. Rich Mountain is a smoke and tobacco free facility. Students and guests are to refrain from the use of all tobacco products while on campus.

Disability Policy
It is the policy of U.A. Rich Mountain to accommodate students with disabilities, pursuant to state and federal law. Any student with a disability who needs accommodations (for example: seating placement, examinations, or access to information on the web) should contact the Associate Vice Chancellor for Student Affairs Office, (479) 394-7622 ext. 1460.

Student Misconduct
Students committing misconduct are subject to disciplinary sanction(s) and/or restrictions. Misconduct or prohibited behavior includes, but is not limited to, endangerment, harassment, disruption, sexual misconduct, dishonesty, illegal drugs and/or alcohol, fire or safety issues, gambling, property violations, computer violations, or other violations as listed in detail in the UA Rich Mountain catalog.

University of Arkansas Rich Mountain Mission
U.A. Rich Mountain exists to provide all residents of the Ouachita Mountain region with exemplary educational and enrichment opportunities to improve the quality of life and standard of living.
Student Support Services: The Student Support Services (SSS) is available to help students reach their educational goals through individualized instruction, counseling, and tutoring. There is no fee for these services. The computer lab is available for student in online classes. SSS is located in the Johnson Learning Commons in the Spencer Building. Technical assistance is available at all RMCC sites.

U.A. Rich Mountain subscribes to tutor.com which uses 24 hour 7 days a week live chat feature to help students with assignments or questions.

Grammarly is also a good resource available to U.A. Rich Mountain students:

Go to http://www.uarichmountain.edu/library/databases Under Databases select **Grammarly** then on the Grammarly website click sign up. At this point, enter Name, Student Email, and Password > Click Sign Up > Check email and click the verify link > Log in to account > Enter access code **sXdEutxUsXwWdijo**

Campus Security: RMCC strives to provide a safe learning environment; therefore, students who know of any security risk are asked to contact a college official. A police officer is on duty at the Waldron Campus.

See Something, Hear Something, Say Something